To view all objection(s) raised by you, visit "Objection Summary" tab to submit and make payment.

View Objection Summary

Question ID	Section	Question	Raise Objection
203641	Logical Reasoning	Puja is the mother-in-law of Sunita who is wife of Rohit. Rohit whose father is Gajanan, is the father of Rupali. Dhanashree is the daughter of Puja. Find how Puja is related to Rupali? 315761 Grandson 315762 Grandmother 315763 Granddaughter 315764 Aunt 315765 Mother-in-law **Correct Option:** 315762 **Candidate Response:** 315762	Raise / View Objection
203642	Logical Reasoning	In a class, Samiksha ranks 12th from the top. Divya is 12 ranks ahead of Medha and 5 ranks behind Samiksha. Reshma who is 7th from the bottom is 29 ranks behind Medha. How many students are there in the class? 315766 61 315767 57 315768 66	Raise / View Objection

315769	63
315770	64

Correct Option: 315770	**Candidate Response:** 315767

203643 Logical Reasoning

Raise / View Objection

There are 80 students admitted to a Music School. Some students can play only violin and some can play only harmonium. 20 children can play both violin and harmonium. If the number of students who can play violin is 30, then how many students can play harmonium? Also, how many can play only harmonium and how many can play only violin

315771	70, 50 and 10 respectively
315772	60, 45 and 12 respectively
315773	65, 50 and 15 respectively
315774	68, 48 and 10 respectively
315775	72, 45 and 11 respectively

Correct Option: 315771	**Candidate Response:** 315772

203644 Logical Reasoning

Raise / View Objection

Given below are two statements, one is labelled as Assertion (A) and other one labelled as Reason (R).

Assertion (A) : Sound travels slower in gases than in solids

Reason (R) : Gases have a lower density than solids.

In light of the above statements, choose the *correct* answer from the options given below.

315776	Both (A) and (R) are true and (R) is the correct explanation of (A).
315777	Both (A) and (R) are true but (R) is NOT the correct explanation of (A).

315778	(A) is true but (R) is false.
315779	(A) is false but (R) is true.
315780	Both(A) and (R) are false.

Correct Option: 315776	**Candidate Response:** 315777

203645 Logical Reasoning

Raise / View Objection

Given below is a statement and two assumptions. These assumptions may or may not be implicit in the statement.

Statement: The travel organizer has abandoned the hill trip.

Assumption I: Trip wasn't profitable for the travel organizer.

Assumption II:unsatisfactory climate lead to the abandonment of this trip.

Choose the correct option from below:

315781	Only Assumption I follows
315782	Only Assumption II follows
315783	Neither Assumption I nor Assumption II follows
315784	Either Assumption I or Assumption II follows
315785	Both Assumption I and Assumption II follow

Correct Option: 315785	**Candidate Response:** 315782

203646 Logical Reasoning

Raise / View Objection

If all the letters of the word 'ALLITERATION' are arranged in the alphabetical order, then the position of how many letters will remain unchanged?

315786	None
315787	One

315788	Three
315789	Two
315790	More than three

Correct Option: 315789	**Candidate Response:** 315787

203647 Logical Reasoning

Raise / View Objection

In a certain coding system, 'rbm std bro pus' means "the puppy is beautiful', 'tnh pus dim std' means 'the sparrow is red', 'pus dim bro pus cus' means 'the sparrow has the puppy'. What is the code for 'has'?

315791	dim
315792	pus
315793	bro
315794	std
315795	cus

Correct Option: 315795	**Candidate Response:** 315792

203648 Logical Reasoning

Raise / View Objection

If INSTITUTE is coded as 9510292325, then the GOVERNMENT is coded as

315796	5672985143
315797	5532432892
315798	5432876852
315799	7645954552

315800	75387127590

Correct Option: 315799	**Candidate Response:** 315797

203649 Logical Reasoning

Raise / View Objection

Rajesh is two years older than Riyansh, who is twice as old as Kailash. If the total of the ages of Rajesh, Riyansh and Kailash are 37, then how old is Riyansh?

315801	12
315802	11
315803	14
315804	20
315805	16

Correct Option: 315803	**Candidate Response:** 315804

203650 Logical Reasoning

Raise / View Objection

In the following series, find which of the given numbers is wrong and does not follow the pattern:

21 105 525 2615 13125 65625

315806	13125
315807	525
315808	65625
315809	2615
315810	105

Correct Option: 315809	**Candidate Response:** 315809

203651 Logical Reasoning

Raise / View Objection

In a certain code language, INSTITUTE is written as EOTUJUVUI. How will MEDICOVER be written in that code language?

315811	RFEDJJOEM
315812	REOJDEJFM
315813	MFEJDJODR
315814	ROJDJEFSM
315815	RFEJDPWFM

Correct Option: 315815	**Candidate Response:** 315815

203652 Logical Reasoning

Raise / View Objection

In the following question, a set of words has been given out of which four are similar and one different. Choose out the odd one.

A) Phi B) Gamma C) Delta D) Peso E) Beta

315816	A
315817	B
315818	C
315819	D
315820	E

Correct Option: 315819	**Candidate Response:** 315816

203653	Logical Reasoning	N is to the East of E, G is to the South of E and L is to the West of G. N is in which direction with respect to L?	Raise / View Objection

315821	South West
315822	North West
315823	South East
315824	North East
315825	South

Correct Option: 315824	**Candidate Response:** 315825

203654	Logical Reasoning	These questions are based on the following information, read the comprehension carefully to answer the given questions. In a classroom, there are two rows of chairs. There are 6 seats in each row of 5 people. In row-1, Ramesh, Sunil, Rajesh, Rohit and Sandip are facing south, while in row-2, Suresh, Aman, Yash, Omkar and Raj are facing north but not necessarily in the same order. Ramesh is sitting second to the right of Rajesh while Sunil is sitting at corner. One of the two vacant seats is in one of the corners. Rohit is sitting immediately right to Sandip. Ramesh and Omkar are related in the same manner as Aman and Rohit are related. Sunil is sitting in front of Raj. Suresh is not sitting with Aman. The person who is sitting in front of Aman, is immediately left to the Sunil. Sandip is sitting diagonally opposite to Raj. Who is sitting immediately next to Suresh?	Raise / View Objection

315826	Aman
315827	Yash
315828	Both Yash and Aman
315829	Raj

315830	Sunil

Correct Option: 315827	**Candidate Response:** 315829

203655 Logical Reasoning

Raise / View Objection

These questions are based on the following information, read the comprehension carefully to answer the given questions.

In a classroom, there are two rows of chairs. There are 6 seats in each row of 5 people. In row-1, Ramesh, Sunil, Rajesh, Rohit and Sandip are facing south, while in row-2, Suresh, Aman, Yash, Omkar and Raj are facing north but not necessarily in the same order.

Ramesh is sitting second to the right of Rajesh while Sunil is sitting at corner. One of the two vacant seats is in one of the corners. Rohit is sitting immediately right to Sandip. Ramesh and Omkar are related in the same manner as Aman and Rohit are related. Sunil is sitting in front of Raj. Suresh is not sitting with Aman. The person who is sitting in front of Aman, is immediately left to the Sunil. Sandip is sitting diagonally opposite to Raj.

Who among the following is sitting immediately next to one of the vacant seats?

315831	Ramesh
315832	Omkar
315833	Rajesh
315834	All Ramesh, Omkar and Rajesh
315835	Sandip

Correct Option: 315834	**Candidate Response:** 315833

203656 Logical Reasoning

Raise / View Objection

These questions are based on the following information, read the comprehension carefully to answer the given questions.

In a classroom, there are two rows of chairs. There are 6 seats in each row of 5 people. In row-1, Ramesh, Sunil, Rajesh, Rohit and Sandip are facing south, while in row-2, Suresh, Aman, Yash, Omkar and Raj are facing north but not necessarily in the same order.

Ramesh is sitting second to the right of Rajesh while Sunil is sitting at corner. One of the two vacant seats is in one of the corners. Rohit is sitting immediately right to Sandip. Ramesh and Omkar are related in the same manner as Aman and Rohit are related. Sunil is sitting in front of Raj. Suresh is not sitting with Aman. The person who is sitting in front of Aman, is immediately left to the Sunil. Sandip is sitting diagonally opposite to Raj.

Select the pair which sits in front of vacant seats.

315836	Yash– Rajesh
315837	Suresh – Sandip
315838	Sandip – Yash
315839	Raj– Sandip
315840	Yash – Rohit

Correct Option: 315838	**Candidate Response:** 315837

203657	Logical Reasoning		Raise / View Objection

These questions are based on the following information, read the comprehension carefully to answer the given questions.

In a classroom, there are two rows of chairs. There are 6 seats in each row of 5 people. In row-1, Ramesh, Sunil, Rajesh, Rohit and Sandip are facing south, while in row-2, Suresh, Aman, Yash, Omkar and Raj are facing north but not necessarily in the same order.

Ramesh is sitting second to the right of Rajesh while Sunil is sitting at corner. One of the two vacant seats is in one of the corners. Rohit is sitting immediately right to Sandip. Ramesh and Omkar are related in the same manner as Aman and Rohit are related. Sunil is sitting in front of Raj. Suresh is not sitting with Aman. The person who is sitting in front of Aman, is immediately left to the Sunil. Sandip is sitting diagonally opposite to Raj.

Who sits immediately next to Rajesh?

315841	Yash
315842	Ramesh
315843	Rohit
315844	Sandip
315845	Suresh

Correct Option: 315843	**Candidate Response:** 315842

203658	Logical Reasoning		Raise / View Objection

These questions are based on the following information, read the comprehension carefully to answer the given questions.

In a classroom, there are two rows of chairs. There are 6 seats in each row of 5 people. In row-1, Ramesh, Sunil, Rajesh, Rohit and Sandip are facing south, while in row-2, Suresh, Aman, Yash, Omkar and Raj are facing north but not necessarily in the same order.

Ramesh is sitting second to the right of Rajesh while Sunil is sitting at corner. One of the two vacant seats is in one of the corners. Rohit is sitting immediately right to Sandip. Ramesh and Omkar are related in the same manner as Aman and Rohit are related. Sunil is sitting in front of Raj. Suresh is not sitting with Aman. The person who is sitting in front of Aman, is immediately left to the Sunil. Sandip is sitting diagonally opposite to Raj.

Which of the following pair/pairs sits/sit opposite each other?

315846	Ramesh – Aman, Rohit – Omkar
315847	Sunil – Yash
315848	Sunil – Yash, Sandip – Raj
315849	Sandip – Raj
315850	Rohit – Suresh, Sunil – Omkar

Correct Option: 315846	**Candidate Response:** 315848

203659 Logical Reasoning

If '+' means '÷', '÷' means '-', '-' means '×' and '×' means '+', then 10+5÷3-2×9 is equal to

315851	6
315852	8
315853	7
315854	10

Raise / View Objection

	10
315855	5

Correct Option: 315855	**Candidate Response:** 315852

203660 Logical Reasoning

Raise / View Objection

Look carefully for the pattern, and then choose which number comes next.

20, 110, 210, 320,

315856	454
315857	452
315858	440
315859	461
315860	425

Correct Option: 315858	**Candidate Response:** 315859

203661 Logical Reasoning

Raise / View Objection

When a word and number arrangement machine is given an input line of words and numbers, it arranges them following a particular rule. The following is an illustration of input and the rearrangement.

INPUT- 3846 9231 7283 4731 8152 3285

STEP I- 3468 1239 2378 1347 1258 2358

STEP II - 1239 1258 1347 2358 2378 3468

STEP III- 23 25 34 35 37 46

STEP IV - 5 7 7 8 10 10

Step IV is the last step of the rearrangement. As per the rules followed in the above steps, find out in each of the following questions the appropriate steps for the given input

Input : 7925 4758 2538 5628 8561 7426 3625 6245 What will the addition of the numbers which is second, forth, sixth and eight from the left end in step IV ?

315861	32
315862	23
315863	38
315864	40
315865	28

Correct Option: 315864 | **Candidate Response:** 315862

203662 | Logical Reasoning

Raise / View Objection

Ram walks 5 km toward south and then turns to the right. After walking 6 km he turns to the left and walks 4 km. Now in which direction is he from the starting place?

315866	West
315867	South
315868	North-East

315869	South-West
315870	North

Correct Option: 315869	**Candidate Response:** 315870

203663 Logical Reasoning

Raise / View Objection

Look carefully for the pattern, and then choose which pair of numbers comes next.

12 16 78 22 26 78 32

315871	36 78
315872	38 75
315873	35 77
315874	36 75
315875	37 79

Correct Option: 315871	**Candidate Response:** 315871

203664 Logical Reasoning

Raise / View Objection

Sushil is taller than Aniket and Rahil is taller than Chaitanya but shorter than vishal. Sushil is shorter than Chaitanya, so who is the tallest among them?

315876	Chaitanya
315877	Sushil
315878	Vishal
315879	Aniket

315880	Rahil

Correct Option: 315878	**Candidate Response:** 315878

203665 Logical Reasoning

Raise / View Objection

If Neetu says, "priya's father Omkar is the only son of my father-in-law Chandrakant", then how is Ruhi, who is the sister of Priya, related to Chandrakant?

315881	Niece
315882	Daughter
315883	Wife
315884	Daughter-in-law
315885	Granddaughter

Correct Option: 315885	**Candidate Response:** 315885

203666 Logical Reasoning

Raise / View Objection

Study the following information carefully and answer the questions given below.

Eight cars viz. H1, H2, H3, H4, H5, H6, H7 and H8 are parked in two parallel rows namely Yellow line and Blue line facing towards north such that the car standing in the Blue line faces the back side of the car standing in front of it in Yellow line. Equal number of cars stand in both the rows.

H3 stands second to the left of H4, which does not stand at any extreme end. H1 and H4 stand in different rows. H5 is third to the right of H2. H8 does not stand at any of the extreme ends. H7, which stands in Blue line is opposite to H1.

Four of the following five are alike in a certain way and thus form a group. Which of the following does not belong to the group?

315886	H2
315887	

[illegible]	H3
315888	H6
315889	H8
315890	H5

Correct Option: 315889	**Candidate Response:** 315888

203667 Logical Reasoning

Raise / View Objection

Study the following information carefully and answer the questions given below.

Eight cars viz. H1, H2, H3, H4, H5, H6, H7 and H8 are parked in two parallel rows namely Yellow line and Blue line facing towards north such that the car standing in the Blue line faces the back side of the car standing in front of it in Yellow line. Equal number of cars stand in both the rows.

H3 stands second to the left of H4, which does not stand at any extreme end. H1 and H4 stand in different rows. H5 is third to the right of H2. H8 does not stand at any of the extreme ends. H7, which stands in Blue line is opposite to H1.

Which of the following cars is parked opposite to H4?

315891	H3
315892	H8
315893	H5

315894	H1
315895	H2

Correct Option: 315892	**Candidate Response:** 315893

203668 Logical Reasoning

Raise / View Objection

Study the following information carefully and answer the questions given below.

Eight cars viz. H1, H2, H3, H4, H5, H6, H7 and H8 are parked in two parallel rows namely Yellow line and Blue line facing towards north such that the car standing in the Blue line faces the back side of the car standing in front of it in Yellow line. Equal number of cars stand in both the rows.

H3 stands second to the left of H4, which does not stand at any extreme end. H1 and H4 stand in different rows. H5 is third to the right of H2. H8 does not stand at any of the extreme ends. H7, which stands in Blue line is opposite to H1.

Which of the following cars is not parked in Yellow line?

315896	H6
315897	H2
315898	H1
315899	H5
315900	H8

Correct Option: 315896	**Candidate Response:** 315898

203669 Logical Reasoning

Raise / View Objection

Study the following information carefully and answer the questions given below.

Eight cars viz. H1, H2, H3, H4, H5, H6, H7 and H8 are parked in two parallel rows namely Yellow line and Blue line facing towards north such that the car standing in the Blue line faces the back side of the car standing in front of it in Yellow line. Equal number of cars stand in both the rows.

H3 stands second to the left of H4, which does not stand at any extreme end. H1 and H4 stand in different rows. H5 is third to the right of H2. H8 does not stand at any of the extreme ends. H7, which stands in Blue line is opposite to H1.

What is the position of H4 with respect to H3?

315901	Immediate left
315902	Second to the left
315903	Second to the right
315904	Immediate right
315905	Both are in different rows

Correct Option: 315903	**Candidate Response:** 315902

203670	Logical Reasoning	Study the following information carefully and answer the questions given below. Eight cars viz. H1, H2, H3, H4, H5, H6, H7 and H8 are parked in two parallel rows namely Yellow line and Blue line facing towards north such that the car standing in the Blue line faces the back side of the car standing in front of it in Yellow line. Equal number of cars stand in both the rows. H3 stands second to the left of H4, which does not stand at any extreme end. H1 and H4 stand in different rows. H5 is third to the right of H2. H8 does not stand at any of the extreme ends. H7, which stands in Blue line is opposite to H1.	Raise / View Objection

Which of the following cars stands opposite to H6?

315906	H1
315907	H5
315908	H7
315909	H4
315910	H2

Correct Option: 315907 | **Candidate Response:** 315907

203671 | Logical Reasoning

Raise / View Objection

Find the alternative which will replace the question mark.

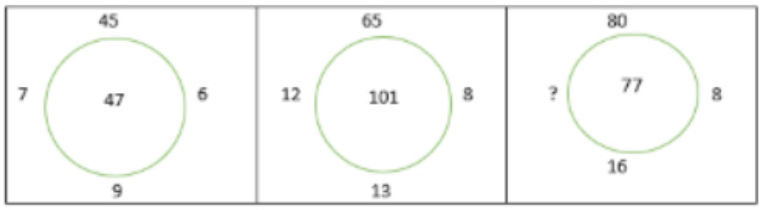

315911	12
315912	14
315913	5
315914	9
315915	3

Correct Option: 315914 | **Candidate Response:** 315914

203672 | Logical Reasoning

Raise / View Objection

If North is replaced by south-east then East will be replaced by which of the following direction?

315916	North-east
315917	South-east
315918	South-west
315919	North-west
315920	South

Correct Option: 315918 | **Candidate Response:** 315919

203673 | Logical Reasoning | Raise / View Objection

Find the odd one from the given data.

APS, EBT, IRP, OTQ, PST

315921	APS
315922	EBT
315923	IRP
315924	OTQ
315925	PST

Correct Option: 315925 | **Candidate Response:** 315921

203674 | Logical Reasoning | Raise / View Objection

Find the odd one out.
Kohima, Imphal, Indore, Ranchi, Jaipur

315926	Indore

315927	Jaipur
315928	Kohima
315929	Ranchi
315930	Imphal

Correct Option: 315926 | **Candidate Response:** 315928

203675 | Logical Reasoning

Raise / View Objection

Ally: Foe :: Admit : ?

315931	Repudiate
315932	Pliant
315933	Humorous
315934	Indiscreet
315935	Tedious

Correct Option: 315931 | **Candidate Response:** 315934

203676 | Logical Reasoning

Raise / View Objection

The following diagram shows the number of people who play table tennis, Chess, Carrom and Ludo. If the total number of people is 600, then what is the number of people who play Chess and Ludo but not Carrom?

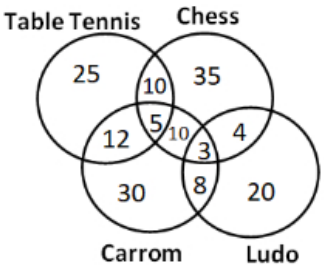

315936	3
315937	4
315938	10
315939	8
315940	5

Correct Option: 315937 | **Candidate Response:** 315939

203677 Logical Reasoning

Raise / View Objection

How many odd digits are there in the following series of digits, each of which is immediately preceded by an even digit, but not immediately followed by an odd digit?

7 2 8 9 1 3 4 5 7 5 8 9 6 9 1 8 2 4 9 2 6

315941	1
315942	2
315943	4
315944	3
315945	5

Correct Option: 315942 | **Candidate Response:** 315942

203678 Logical Reasoning

Raise / View Objection

If 'P+Q' means P is brother of Q, 'P*Q' means P is sister of Q, 'P-Q' means P is mother of Q and 'P@Q' means P is father of Q then which of the following is correct about E+F@G*H?

315946	G is mother of H

315947	G is daughter of F
315948	F is brother of E
315949	E is sister of H
315950	F is sister of E

Correct Option: 315948 | **Candidate Response:** 315949

203679 Logical Reasoning

Raise / View Objection

In a certain code, "SHRIJEET" is written as "QFPGHCCR". How is "INTEREST" written in that code?

315951	GLRCPCQR
315952	BWKXUAA
315953	GYQQGML
315954	SHXXHLH
315955	GWPPNCV

Correct Option: 315951 | **Candidate Response:** 315951

203680 Logical Reasoning

Raise / View Objection

Find the correct alternative which will replace the question mark?

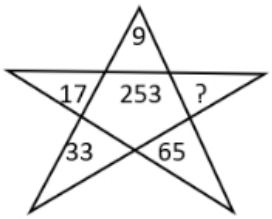

315956	103

315957	129
315958	156
315959	98
315960	132

Correct Option: 315957 | **Candidate Response:** 315957

203681 | Logical Reasoning

Raise / View Objection

Study the information carefully and answer the questions given below.

Seven boxes are placed one above other, but not necessarily in the same order. Each of them is containing different food items. Box F does not contain biscuits. Box L is not placed above box G. The box which contains Chocolate is placed immediately below box F. There are two boxes placed between box G and the box which contains Chocolate. Box G is not placed above the box which contains chocolates. The box which contains burgers is placed below box G. Three boxes are placed between box M and the box which contains burgers. The box which contains Laddus is placed immediately below box M. The box which contains Samosa is placed immediately below box H. Only one box is placed between box L and box P. Neither box L nor box F contains Momos. Box P does not contain Samosa. Box H contains neither Momos nor dry fruits. The box which contains biscuits is not placed at the top. Box I does not contain Biscuit

Which of the following box is placed just below the box which contains Dryfruits?

315961	P
315962	H
315963	G
315964	L
315965	I

		Correct Option: 315962 **Candidate Response:** 315962	
203682	Logical Reasoning	Study the information carefully and answer the questions given below. Seven boxes are placed one above other, but not necessarily in the same order. Each of them is containing different food items. Box F does not contain biscuits. Box L is not placed above box G. The box which contains Chocolate is placed immediately below box F. There are two boxes placed between box G and the box which contains Chocolate. Box G is not placed above the box which contains chocolates. The box which contains burgers is placed below box G. Three boxes are placed between box M and the box which contains burgers. The box which contains Laddus is placed immediately below box M. The box which contains Samosa is placed immediately below box H. Only one box is placed between box L and box P. Neither box L nor box F contains Momos. Box P does not contain Samosa. Box H contains neither Momos nor dry fruits. The box which contains biscuits is not placed at the top. Box I does not contain Biscuit How many boxes are placed between H and I?	Raise / View Objection
		315966: 2 315967: 3 315968: 4 315969: 1 315970: 5	
		Correct Option: 315968 **Candidate Response:** 315967	
203683	Logical Reasoning		Raise / View Objection

Study the information carefully and answer the questions given below.

Seven boxes are placed one above other, but not necessarily in the same order. Each of them is containing different food items. Box F does not contain biscuits. Box L is not placed above box G. The box which contains Chocolate is placed immediately below box F. There are two boxes placed between box G and the box which contains Chocolate. Box G is not placed above the box which contains chocolates. The box which contains burgers is placed below box G. Three boxes are placed between box M and the box which contains burgers. The box which contains Laddus is placed immediately below box M. The box which contains Samosa is placed immediately below box H. Only one box is placed between box L and box P. Neither box L nor box F contains Momos. Box P does not contain Samosa. Box H contains neither Momos nor dry fruits. The box which contains biscuits is not placed at the top. Box I does not contain Biscuit

Which of the following box contains Laddus?

315971	H
315972	G
315973	L
315974	P
315975	I

Correct Option: 315974	**Candidate Response:** 315973

203684	Logical Reasoning		Raise / View Objection

Study the information carefully and answer the questions given below.

Seven boxes are placed one above other, but not necessarily in the same order. Each of them is containing different food items. Box F does not contain biscuits. Box L is not placed above box G. The box which contains Chocolate is placed immediately below box F. There are two boxes placed between box G and the box which contains Chocolate. Box G is not placed above the box which contains chocolates. The box which contains burgers is placed below box G. Three boxes are placed between box M and the box which contains burgers. The box which contains Laddus is placed immediately below box M. The box which contains Samosa is placed immediately below box H. Only one box is placed between box L and box P. Neither box L nor box F contains Momos. Box P does not contain Samosa. Box H contains neither Momos nor dry fruits. The box which contains biscuits is not placed at the top. Box I does not contain Biscuit

Which of the following box is placed just below the box which contains Momos?

315976	The box which contains burgers
315977	M
315978	The box which contains biscuits
315979	G
315980	I

Correct Option: 315978	**Candidate Response:** 315977

203685	Logical Reasoning		Raise / View Objection

Study the information carefully and answer the questions given below.

Seven boxes are placed one above other, but not necessarily in the same order. Each of them is containing different food items. Box F does not contain biscuits. Box L is not placed above box G. The box which contains Chocolate is placed immediately below box F. There are two boxes placed between box G and the box which contains Chocolate. Box G is not placed above the box which contains chocolates. The box which contains burgers is placed below box G. Three boxes are placed between box M and the box which contains burgers. The box which contains Laddus is placed immediately below box M. The box which contains Samosa is placed immediately below box H. Only one box is placed between box L and box P. Neither box L nor box F contains Momos. Box P does not contain Samosa. Box H contains neither Momos nor dry fruits. The box which contains biscuits is not placed at the top. Box I does not contain Biscuit

Which of the following box contains burgers?

315981	M
315982	I
315983	G
315984	H
315985	F

Correct Option: 315982	**Candidate Response:** 315983

203686 Logical Reasoning

How many pairs of letters (both forward and backward direction) are there in the word "STRENGTHEN" each of which have as many letters between them in the word as they have between them in the English alphabetical series?

Raise / View Objection

315986	1
315987	2
315988	3

	3
315989	4
315990	5

Correct Option: 315987	**Candidate Response:** 315989

203687 Logical Reasoning

Raise / View Objection

If all the vowels of the word 'TREATMENT' are replaced by its succeeding letter according to the English alphabet and all the consonant are replaced with their previous letter according to the English alphabet and then all the letters are arranged in the alphabetical order, then how many letter are there between the third letter from the left and fourth letter from the right in the English alphabetic series?

315991	6
315992	12
315993	9
315994	10
315995	11

Correct Option: 315994	**Candidate Response:** 315992

203688 Logical Reasoning

Raise / View Objection

If in the number 546839271, 1 is added to first, third, fifth, seventh and ninth digit and 1 is subtracted from the second, fourth, sixth and eighth digits, then all digits are arranged in descending order from left to right. Which of the following digit is 4th from the right end?

315996	7
315997	6
315998	3

315999	4
316000	5

Correct Option: 315999	**Candidate Response:** 315997

203689 Logical Reasoning

Raise / View Objection

Choose the word that best completes the comparison.

particular: fussy:: _____: subservient

316001	meek
316002	above
316003	cranky
316004	uptight
316005	clever

Correct Option: 316001	**Candidate Response:** 316003

203690 Logical Reasoning

Raise / View Objection

If laptop is called fan, basket is called laptop, lift is called basket, fan is called book and book is called lift. Which of the following is used to go on the upper floor of the building?

316006	Laptop
316007	Basket
316008	Book
316009	Fan

316010	Lift

Correct Option: 316007	**Candidate Response:** 316010

203691 Logical Reasoning

Raise / View Objection

Look carefully for the pattern, and then choose which pair of numbers comes next.

4 7 26 10 13 20 16

316011	14 4
316012	14 17
316013	18 14
316014	19 13
316015	19 14

Correct Option: 316015	**Candidate Response:** 316011

203692 Logical Reasoning

Raise / View Objection

Which word does NOT belong with the others?

1. Ignore

2. Shrug off

3. Spurn

4. Disregard

5. Bloom

316016	1
316017	2
316018	3

	3
316019	4
316020	5

Correct Option: 316020	**Candidate Response:** 316019

203693 Logical Reasoning

Raise / View Objection

Find the word that names a necessary part of the underlined word.

Vibration

1. Motion
2. Electricity
3. Science
4. Sound
5. Electron

316021	1
316022	2
316023	3
316024	4
316025	5

Correct Option: 316021	**Candidate Response:** 316022

203694 Logical Reasoning

Raise / View Objection

Find out which of the answer choice completes the same relationship.

Yard is to inch as quart is to

1. Gallon.

2. Ounce.

3. Milk.

4. Liquid.

5. Solid

316026	1
316027	2
316028	3
316029	4
316030	5

Correct Option: 316027	**Candidate Response:** 316028

203695 Logical Reasoning

Raise / View Objection

Find the word that completes the bottom row of words.

rule command dictate

doze sleep _____

316031	snore
316032	govern
316033	awaken
316034	hibernate
316035	stringent

		Correct Option: 316034	**Candidate Response:** 316033

203696	Logical Reasoning	Here are some words translated from an artificial language. tamceno means sky blue cenorax means blue cheese aplmitl means star bright Which word could mean “bright sky”? 316036 cenotam 316037 mitltam 316038 raxmitl 316039 aplceno 316040 oaplexr **Correct Option:** 316037 **Candidate Response:** 316036	Raise / View Objection
203697	Logical Reasoning		Raise / View Objection

		Erratic Behavior occurs when an individual acts in a manner that lacks consistency, regularity, and uniformity. Which situation below is the best example of Erratic Behavior? 1. Fatima cannot contain her anger whenever the subject of local politics is discussed. 2. Viraj has just been told that he is being laid off. Before leaving his supervisor's office, he punches a hole in the door. 3. Rugved has visited the dealership several times, but she still cannot decide which car to buy. 4. In the past month, Sagar, who has been a model employee for three years, has repeatedly called in sick, forgotten important meetings, and been verbally abusive to colleagues. 5. Shreya cannot control her emotions whenever students discuss about Indian army. 316041 1 316042 2 316043 3 316044 4 316045 5 **Correct Option:** 316044 **Candidate Response:** 316042	
203698	Logical Reasoning	There are 23 steps to reach a temple. On descending from the temple, Ram takes two steps in the same time Shyam ascends one step. If they start to work simultaneously, at which step will they meet each other from the bottom? 316046 8TH 316047 10TH 316048 9TH	Raise / View Objection

316049	11TH
316050	15TH

Correct Option: 316046	**Candidate Response:** 316050

203699 Logical Reasoning

Raise / View Objection

The film director Ruturaj wants an actress for the lead role of Rosy who perfectly fits the description that appears in the original screenplay. He is not willing to consider actresses who do not resemble the character as she is described in the screenplay, no matter how talented they are. The screenplay describes Rosy as an average-sized, forty-something redhead, with deep brown eyes, very fair skin, and a brilliant smile. The casting agent has four actresses in mind.

1- Veena is a stunning red-haired beauty who is 5'9" and in her mid-twenties. Her eyes are brown and she has an olive complexion.

2- Rajani has red hair, big brown eyes, and a fair complexion. She is in her mid-forties and is 5'5".

3- Puja is 5'4" and of medium build. She has red hair, brown eyes, and is in her early forties.

4- Sulbha is a blue-eyed redhead in her early thirties. She's of very slight build and stands at 5'.

Which two actresses should the casting agent send to meet the director?

316051	Veena, Rajani
316052	Rajani, Puja
316053	Veena, Sulbha
316054	Rajani, Sulbha
316055	Puja, Sulbha

Correct Option: 316052	**Candidate Response:** 316054

203700 Logical

	Reasoning	Statement I: Arun has four vehicles. Statement II: Two of the vehicles are red. Statement III: One of the vehicles is a minivan. If the first three statements are facts, which of the following statements must also be a fact? I. Arun has a red minivan. II. Arun has three cars. III. Arun's favorite color is red.	Raise / View Objection

316056	I only
316057	II only
316058	II and III only
316059	III only
316060	None of the statements is a known fact.

Correct Option: 316060	**Candidate Response:** 316059

203701	Logical Reasoning	Four defensive football players are chasing the opposing wide receiver who has the ball. Amol is directly behind the ball carrier. Jeet and Niraj are side by side behind Amol. Nikhil is behind Jeet and Niraj. Amol tries for the tackle but misses and falls. Niraj trips. Which defensive player tackles the receiver?	Raise / View Objection

316061	Niraj
316062	Nikhil
316063	Jeet
316064	Amol
316065	Rohit

Correct Option: 316063	**Candidate Response:** 316065

203702 Logical Reasoning

Raise / View Objection

At the football game, Hemant was sitting in seat 253. Manoj was sitting to the right of Hemant in seat 254. In the seat to the left of Hemant was Gopal. Iqbal was sitting to the left of Gopal. Which seat is Iqbal sitting in?

316066	251
316067	257
316068	256
316069	255
316070	252

Correct Option: 316066	**Candidate Response:** 316067

203703 Logical Reasoning

Raise / View Objection

Read the information carefully and answer the questions below.

A weekly television show routinely stars six actors, Jeevan, Karan, Lalit, Manish, Nishant, and Omkar. Since the show has been on the air for a long time, some of the actors are good friends and some do not get along at all. In an effort to keep peace, the director sees to it that friends work together and enemies do not. Also, as the actors have become more popular, some of them need time off to do other projects. To keep the schedule working, the director has a few things she must be aware of:

1.Jeevan will only work on episodes on which Manish is working.

2. Nishant will not work with Karan under any circumstances.

3.Manish can only work every other week, in order to be free to film a movie

4. At least three of the actors must appear in every weekly episode.

In a show about Lalit getting a job at the same company Jeevan already works for and Karan used to work for, all three actors will appear. Which of the following is true about the other actors who may appear?

316071	Manish, Nishant, and Omkar must all appear.
316072	Manish may appear and Nishant must appear.
316073	Manish must appear and Omkar may appear.
316074	Omkar may appear and Nishant may appear.
316075	Only Omkar may appear

Correct Option: 316073	**Candidate Response:** 316072

203704 Logical Reasoning

Raise / View Objection

Read the information carefully and answer the questions below.

A weekly television show routinely stars six actors, Jeevan, Karan, Lalit, Manish, Nishant, and Omkar. Since the show has been on the air for a long time, some of the actors are good friends and some do not get along at all. In an effort to keep peace, the director sees to it that friends work together and enemies do not. Also, as the actors have become more popular, some of them need time off to do other projects. To keep the schedule working, the director has a few things she must be aware of:

1.Jeevan will only work on episodes on which Manish is working.

2. Nishant will not work with Karan under any circumstances.

3.Manish can only work every other week, in order to be free to film a movie

4. At least three of the actors must appear in every weekly episode.

Next week, the show involves Nishant's new car and Omkar's new refrigerator. Which of the following is true about the other actors who may appear?

316076	Manish, Jeevan, Lalit, and Karan all may appear.
316077	Jeevan, Lalit, and Karan must appear.
316078	

316078	Only Karan may appear.
316079	Only Lalit may appear
316080	Lalit and Karan must appear.

Correct Option: 316079	**Candidate Response:** 316078

203705 Logical Reasoning

Raise / View Objection

Read the information carefully and answer the questions below.

At a small company, parking spaces are reserved for the top executives: CEO, president, vice president, secretary, and treasurer—with the spaces lined up in that order. The parking lot guard can tell at a glance if the cars are parked correctly by

looking at the colour of the cars. The cars are yellow, green, purple, red, and blue, and the executives' names are Ajay, Bipin, Chetan, Damodar, and Erik.

- The car in the first space is red.
- A blue car is parked between the red car and the green car.
- The car in the last space is purple.
- The secretary drives a yellow car.
- Ajay's car is parked next to Damodar's.
- Erik drives a green car.
- Bipin's car is parked between Chetan's and Erik's.
- Damodar's car is parked in the last space.

What colour is the vice president's car?

316081	green
316082	yellow
316083	blue
316084	purple
316085	red

	red

Correct Option: 316081	**Candidate Response:** 316082

203706 | Logical Reasoning

Raise / View Objection

Read the information carefully and answer the questions below.

At a small company, parking spaces are reserved for the top executives: CEO, president, vice president, secretary, and treasurer—with the spaces lined up in that order. The parking lot guard can tell at a glance if the cars are parked correctly by

looking at the colour of the cars. The cars are yellow, green, purple, red, and blue, and the executives' names are Ajay, Bipin, Chetan, Damodar, and Erik.

- The car in the first space is red.
- A blue car is parked between the red car and the green car.
- The car in the last space is purple.
- The secretary drives a yellow car.
- Ajay's car is parked next to Damodar's.
- Erik drives a green car.
- Bipin's car is parked between Chetan's and Erik's.
- Damodar's car is parked in the last space.

Who is the CEO?

316086	Ajay
316087	Bipin
316088	Chetan
316089	Damodar
316090	Erik

Correct Option: 316088	**Candidate Response:** 316087

203707	Logical Reasoning	Read the information carefully and answer the questions below. At a small company, parking spaces are reserved for the top executives: CEO, president, vice president, secretary, and treasurer—with the spaces lined up in that order. The parking lot guard can tell at a glance if the cars are parked correctly by looking at the colour of the cars. The cars are yellow, green, purple, red, and blue, and the executives' names are Ajay, Bipin, Chetan, Damodar, and Erik. ■ The car in the first space is red. ■ A blue car is parked between the red car and the green car. ■ The car in the last space is purple. ■ The secretary drives a yellow car. ■ Ajay's car is parked next to Damodar's. ■ Erik drives a green car. ■ Bipin's car is parked between Chetan's and Erik's. ■ Damodar's car is parked in the last space. Who is the secretary? 316091 Erik 316092 Damodar 316093 Chetan 316094 Bipin 316095 Ajay **Correct Option:** 316095 **Candidate Response:** 316092	Raise / View Objection
203708	Logical Reasoning		

Five roommates—Ranjita, Sanjana, Teena, Ujwala, and Vijita—each do one housekeeping task— mopping, sweeping, laundry, vacuuming, or dusting—one day a week, Monday through Friday.

- Vijita does not vacuum and does not do her task on Tuesday.
- Sanjana does the dusting, and does not do it on Monday or Friday.
- The mopping is done on Thursday.
- Teena does her task, which is not vacuuming, on Wednesday.
- The laundry is done on Friday, and not by Ujwala.
- Ranjita does her task on Monday

When does Sanjana do the dusting?

316096	Friday
316097	Monday
316098	Tuesday
316099	Wednesday
316100	Thursday

Correct Option: 316098	**Candidate Response:** 316097

Raise / View Objection

203709 Logical Reasoning

Five roommates—Ranjita, Sanjana, Teena, Ujwala, and Vijita—each do one housekeeping task— mopping, sweeping, laundry, vacuuming, or dusting—one day a week, Monday through Friday.

- Vijita does not vacuum and does not do her task on Tuesday.
- Sanjana does the dusting, and does not do it on Monday or Friday.
- The mopping is done on Thursday.
- Teena does her task, which is not vacuuming, on Wednesday.
- The laundry is done on Friday, and not by Ujwala.
- Ranjita does her task on Monday

Raise / View Objection

What task does Teena do on Wednesday?

316101	vacuuming
316102	dusting
316103	mopping
316104	sweeping
316105	laundry

Correct Option: 316104	**Candidate Response:** 316102

203710	Logical Reasoning	Five roommates—Ranjita, Sanjana, Teena, Ujwala, and Vijita—each do one housekeeping task— mopping, sweeping, laundry, vacuuming, or dusting—one day a week, Monday through Friday. ■ Vijita does not vacuum and does not do her task on Tuesday. ■ Sanjana does the dusting, and does not do it on Monday or Friday. ■ The mopping is done on Thursday. ■ Teena does her task, which is not vacuuming, on Wednesday. ■ The laundry is done on Friday, and not by Ujwala. ■ Ranjita does her task on Monday What day is the vacuuming done?	Raise / View Objection

316106	Friday
316107	Monday

316108	Tuesday
316109	Wednesday
316110	Thursday

Correct Option: 316107	**Candidate Response:** 316107

203711 Logical Reasoning

Raise / View Objection

Five roommates—Ranjita, Sanjana, Teena, Ujwala, and Vijita—each do one housekeeping task— mopping, sweeping, laundry, vacuuming, or dusting—one day a week, Monday through Friday.

- Vijita does not vacuum and does not do her task on Tuesday.
- Sanjana does the dusting, and does not do it on Monday or Friday.
- The mopping is done on Thursday.
- Teena does her task, which is not vacuuming, on Wednesday.
- The laundry is done on Friday, and not by Ujwala.
- Ranjita does her task on Monday

What task does Vijita do?

316111	vacuuming
316112	dusting
316113	mopping
316114	sweeping
316115	laundry

Correct Option: 316115	**Candidate Response:** 316112

203712 Logical Reasoning

Five roommates—Ranjita, Sanjana, Teena, Ujwala, and Vijita—each do one housekeeping task— mopping, sweeping, laundry, vacuuming, or dusting—one day a week, Monday through Friday.

- Vijita does not vacuum and does not do her task on Tuesday.
- Sanjana does the dusting, and does not do it on Monday or Friday.
- The mopping is done on Thursday.
- Teena does her task, which is not vacuuming, on Wednesday.
- The laundry is done on Friday, and not by Ujwala.
- Ranjita does her task on Monday

What day does Ujwala do her task?

316116	Monday
316117	Tuesday
316118	Wednesday
316119	Thursday
316120	Friday

Correct Option: 316119	**Candidate Response:** 316117

Raise / View Objection

203713 Logical Reasoning

How many meaningful words can be formed using the 3rd ,4th,6thand 7th alphabet of the word "PUBLICATIONS"?

316121	One
316122	Two

Raise / View Objection

316123	None
316124	More than three
316125	Three

Correct Option: 316123	**Candidate Response:** 316124

203714 Logical Reasoning

Raise / View Objection

Given below are two statements, one is labelled as Assertion (A) and other one labelled as Reason (R).

Assertion (A) : Steel is used in the construction of buildings and bridges.

Reason (R) :Steel is more elastic and its elastic limit is high.

In light of the above statements, choose the *most appropriate* answer from the options given below.

316126	Both (A) and (R) are correct and (R) is the correct explanation of (A).
316127	Both (A) and (R) are correct but (R) is the NOT the correct explanation of (A).
316128	(A) is correct but (R) is incorrect.
316129	(A) is incorrect but (R) is correct.
316130	Both A and R are not correct

Correct Option: 316126	**Candidate Response:** 316127

203715 Logical Reasoning

Raise / View Objection

Forest fires feed on decades-long accumulations of debris and leap from the tops of young trees into the branches of mature trees. Fires that jump from treetop to treetop can be devastating. In old-growth forests, however, the shade of mature trees keeps thickets of small trees from sprouting, and the lower branches of mature trees are too high to catch the flames.

This paragraph best supports the statement that

1. forest fire damage is reduced in old-growth forests.

2. small trees should be cut down to prevent forest fires.

3. mature trees should be thinned out to prevent forest fires.

4. forest fires do the most damage in old growth forests.

5. old-growth forests have a larger accumulation of forest debris.

316131	1
316132	2
316133	3
316134	4
316135	5

Correct Option: 316131	**Candidate Response:** 316132

203716	Abstract Reasoning	Which shape comes next in the sequence? 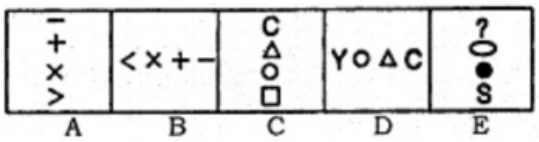	Raise / View Objection
		316136	

	
316137	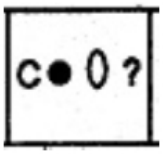
316138	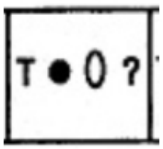
316139	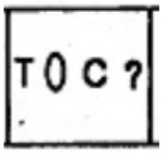
316140	

Correct Option: 316138	**Candidate Response:** 316137

203717 Abstract Reasoning

Raise / View Objection

Which shape comes next in the sequence?

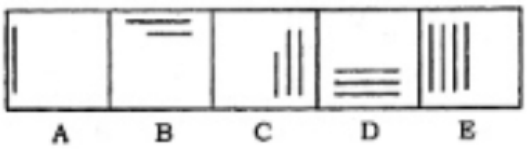

316141	
316142	
316143	

	
316144	
316145	

Correct Option: 316142	**Candidate Response:** 316142

203718 Abstract Reasoning

Raise / View Objection

Find the number of triangles in the following figure

316146	27
316147	25
316148	23
316149	21
316150	29

Correct Option: 316146	**Candidate Response:** 316146

203719 Abstract Reasoning

Raise / View Objection

Find the number of triangles from the figure

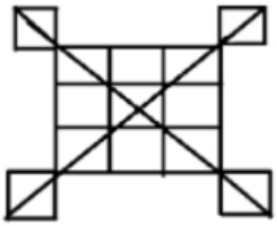

316151	20
316152	24
316153	28
316154	29
316155	32

Correct Option: 316153	**Candidate Response:** 316155

203720 Abstract Reasoning

Raise / View Objection

Select the figure that will come next in the following series.

316156	
316157	
316158	

316159	
316160	Can not be determined

Correct Option: 316158	**Candidate Response:** 316156

203721 Abstract Reasoning

Raise / View Objection

Find the number of triangle in the given figure.

316161	12
316162	18
316163	22
316164	26
316165	28

Correct Option: 316162	**Candidate Response:** 316163

203722 Abstract Reasoning

Raise / View Objection

Select the correct mirror image of the given figure when the mirror is placed to the right of the figure.

6 4 E K P C 9 2

316166	2 9 C P K E 4 6
316167	2 9 C P K E 4 6
316168	2 9 C P K E 4 6
316169	2 9 C P K E 4 6
316170	Can not be determined

Correct Option: 316167	**Candidate Response:** 316167

203723 Abstract Reasoning

Raise / View Objection

From the following, choose the alternative that correctly represents the water image of the word

N U C L E A R

316171	R A E L C U N
316172	N U C L E A R
316173	N U C L E A R
316174	N U C L E A R
316175	No one from the above

Correct Option: 316174	**Candidate Response:** 316174

203724 Abstract Reasoning

Which figure is the odd one out?

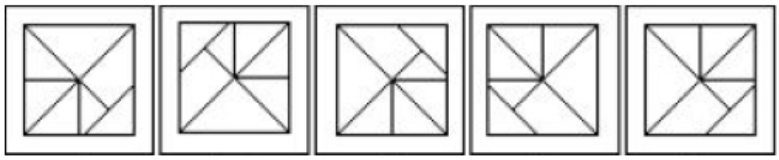

A B C D E

316176	A
316177	B
316178	C
316179	D
316180	E

Correct Option: 316180	**Candidate Response:** 316177

Raise / View Objection

203725 Abstract Reasoning

Which figure is the odd one out?

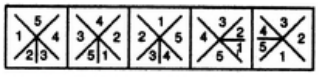

(1) (2) (3) (4) (5)

316181	1
316182	2
316183	3
316184	4
316185	

Raise / View Objection

	5

Correct Option: 316182	**Candidate Response:** 316182

203726 Abstract Reasoning

Raise / View Objection

Which figure completes the statement?

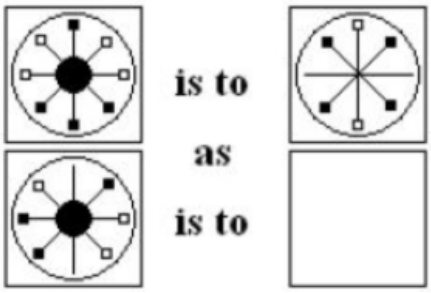

316186	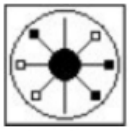 A
316187	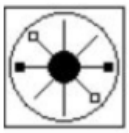 B
316188	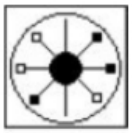 C
316189	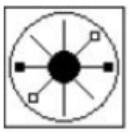 D
316190	Not any of the above

Correct Option: 316189	**Candidate Response:** 316188

203727 Abstract Reasoning

Raise / View Objection

Choosing from options given which figure completes the series below?



316191	
316192	
316193	
316194	
316195	

Correct Option: 316195	**Candidate Response:** 316195

203728	Abstract Reasoning		Raise / View Objection

Choosing from options given which figure completes the series below?

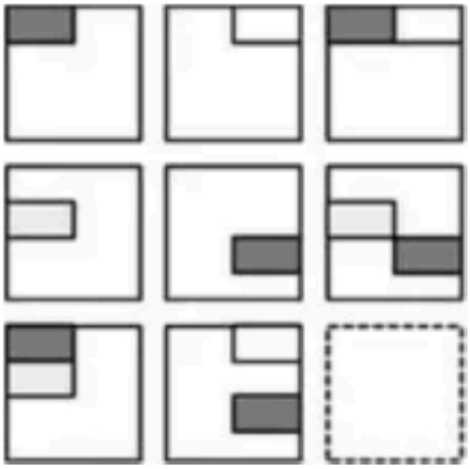

316196	
316197	
316198	
316199	
316200	

Correct Option: 316199	**Candidate Response:** 316196

203729	Abstract Reasoning		Raise / View Objection

Choose the figure that follows from the following pattern?

316201	
316202	
316203	
316204	
316205	

Correct Option: 316205	**Candidate Response:** 316202

203730	Abstract Reasoning	Which shape or pattern on the right belongs with the two on the left? 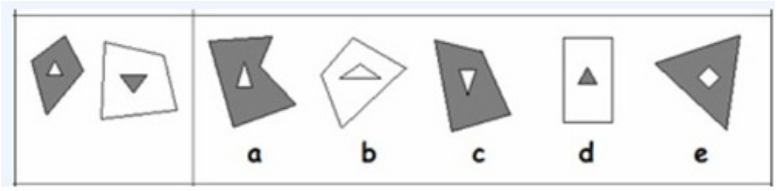 	Raise / View Objection

316206	a
316207	b
316208	c
316209	d

316210	e

Correct Option: 316208	**Candidate Response:** 316208

203731 Abstract Reasoning

Raise / View Objection

Which figure is the odd one out?



A B C D E

316211	E
316212	A
316213	B
316214	D
316215	C

Correct Option: 316215	**Candidate Response:** 316212

203732 Abstract Reasoning

Raise / View Objection

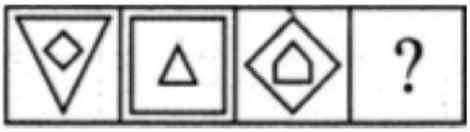

316216	
316217	

316218	
316219	
316220	

Correct Option: 316219	**Candidate Response:** 316216

203733 Abstract Reasoning

Raise / View Objection

Which of the following finished patterns can be obtained from the piece of cardboard (X) shown below?

316221	1
316222	2
316223	3
316224	4
316225	Not any of the above

Correct Option: 316221	**Candidate Response:** 316222

203734 Abstract Reasoning

Select the alternative which represents three out of the five alternative figures which when fitted into each other would form a complete square.



(1) (2) (3) (4) (5)

316226	1,2, 4
316227	3.4.5
316228	1,2,3
316229	1,3,5
316230	5,2,4

Correct Option: 316229	**Candidate Response:** 316229

Raise / View Objection

203735 Abstract Reasoning

Select the alternative which represents three out of the five alternative figures which when fitted into each other would form an equilateral triangle.

(1) (2) (3) (4) (5)

316231	4,3,2
316232	2,4,5
316233	1,3,4
316234	

Raise / View Objection

	3,4,5
316235	2,4,5

Correct Option: 316234	**Candidate Response:** 316233

203736 Abstract Reasoning

Raise / View Objection

Select the figure which satisfies the same conditions of placement of the dots as in Figure-X.

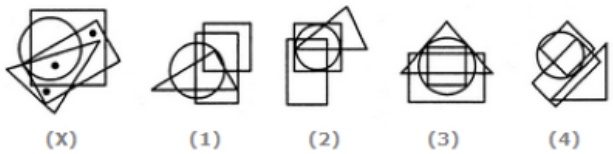

316236	1
316237	2
316238	3
316239	4
316240	not any of the above

Correct Option: 316236	**Candidate Response:** 316238

203737 Abstract Reasoning

Raise / View Objection

Group the given figures into three classes using each figure only once.

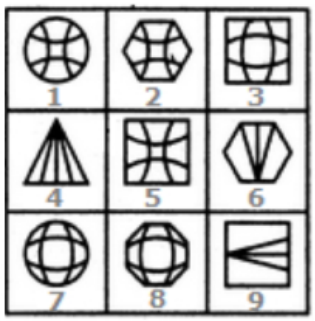

316241	1,2,5 ; 3,7,8 ; 4,6,9
316242	

316242	1,7,2 ; 3,9,6 ; 4,5,8
316243	2,3,8 ; 4,6,9 ; 1,5,7
316244	5,6,9 ; 3,4,1 ; 2,7,8
316245	4,5,8 ; 2,3,1 ; 9,7,8

Correct Option: 316241 | **Candidate Response:** 316241

203738 Abstract Reasoning

Raise / View Objection

Identify the figure that completes the pattern.

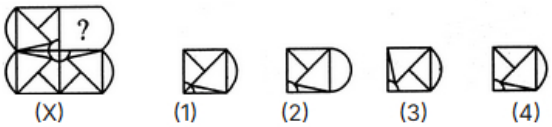

316246	1
316247	2
316248	3
316249	4
316250	All correct

Correct Option: 316249 | **Candidate Response:** 316249

203739 Abstract Reasoning

Raise / View Objection

Find out the alternative figure which contains figure (X) as its part.

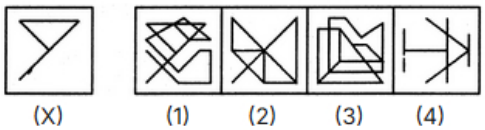

316251	1

316252	2
316253	3
316254	4
316255	Not any of the above

Correct Option: 316251 | **Candidate Response:** 316252

203740 Abstract Reasoning

Raise / View Objection

Select a figure from amongst the Answer Figures which will continue the same series as established by the five Problem Figures.

Problem Figures: Answer Figures:

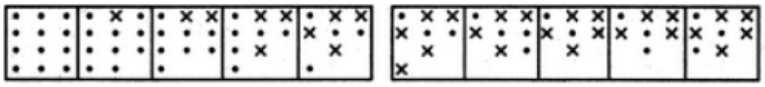

(A) (B) (C) (D) (E) (1) (2) (3) (4) (5)

316256	1
316257	2
316258	3
316259	4
316260	5

Correct Option: 316258 | **Candidate Response:** 316260

203741 Quantitative Aptitude

Raise / View Objection

Two trains P and Q start simultaneously in the opposite direction from two points A and B and arrive at their destinations 25 and 16 hours respectively after their meeting each other. At what speed does the second train Q travel if the first train travels at 100 km/h?

316261	100 km/hr

	100 km/hr
316262	125 km/hr
316263	120 km/hr
316264	140 km/hr
316265	115 km/hr

Correct Option: 316262	**Candidate Response:** 316263

203742 Quantitative Aptitude

Raise / View Objection

The sum of present ages of Anish, Ajay and Anvit is 75 years. If 5 years ago the ratio of their ages was 3 : 4 : 5, What is the present age of Ajay?

316266	65 years
316267	28 years
316268	32 years
316269	44 years
316270	25 years

Correct Option: 316270	**Candidate Response:** 316266

203743 Quantitative Aptitude

Raise / View Objection

Amit cycled from his house to the garden at speed of 12 km/hr and came back to his house at the speed of 6 km/hr. if the total time taken by Amit to complete the journey was 6 hours, then find the distance between Amit's House and garden?

316271	32 km
316272	28 km
316273	24 km
316274	36 km
316275	40 km

Correct Option: 316273 | **Candidate Response:** 316273

203744 | Quantitative Aptitude

Raise / View Objection

What is the probability of getting a red numbered card greater than 6 from a well shuffled deck of 52 cards?

316276	4 / 13
316277	2 / 13
316278	5/13
316279	3/13
316280	6/13

Correct Option: 316277 | **Candidate Response:** 316276

203745 | Quantitative Aptitude

Raise / View Objection

A bag contains 10 black balls, 5 red balls and 5 white balls and a ball is drawn randomly from it. What is the probability of getting either a red or a white ball?

316281	1/4
316282	1/2

316283	3/4
316284	1
316285	4/5

Correct Option: 316282	**Candidate Response:** 316282

203746 Quantitative Aptitude

Raise / View Objection

In how many ways can the word 'ESPECIALLY' be arranged such that the vowels always come together?

316286	42600
316287	25200
316288	10080
316289	30240
316290	29242

Correct Option: 316289	**Candidate Response:** 316289

203747 Quantitative Aptitude

Raise / View Objection

The market value of a share is 35% of the face value and 30% less than the selling price. Find the profit or loss percentage.

316291	50 % loss
316292	50% profit
316293	49 % profit
316294	48 % loss
316295	

	45% profit

Correct Option: 316291	**Candidate Response:** 316295

203748 Quantitative Aptitude

Raise / View Objection

It was Sunday on 12 February 1882. What was the day on 12 February 1885?

316296	Wednesday
316297	Thursday
316298	Friday
316299	Saturday
316300	Sunday

Correct Option: 316297	**Candidate Response:** 316299

203749 Quantitative Aptitude

Raise / View Objection

The outer rolling surfaces of 8 similar small rollers, each having a radius of 9 cm and length as 12 cm are to be painted at a rate of Rs.15 / cm^2. What will be the total cost of painting (in Rs.)?

316301	80788.7
316302	80488.7
316303	81280.5
316304	81388.8
316305	82487.2

Correct Option: 316304	**Candidate Response:** 316302

203750	Quantitative Aptitude	A courtyard is 30 meters long and 20 meters broad and is to be paved with bricks of dimensions 15 cm by 10 cm. What will be the number of bricks required? 316306: 25000 316307: 30000 316308: 40000 316309: 35000 316310: 42000 **Correct Option:** 316308 **Candidate Response:** 316308	Raise / View Objection
203751	Quantitative Aptitude	A man invested x rupees for y years at a rate of 3.25% per annum simple interest. If he received 3.25x after y years, find the value of y. 316311: 68.22 316312: 67.32 316313: 65.33 316314: 69.23 316315: 71.32 **Correct Option:** 316314 **Candidate Response:** 316312	Raise / View Objection
203752	Quantitative Aptitude		Raise / View Objection

A mixture containing 43% of acid is mixed with another mixture containing 82% acid in the ratio 10: 9. Find the percentage of acid in the mixture formed.

316316	60.45 %
316317	61.25%
316318	64.25%
316319	63.20 %
316320	61.47%

Correct Option: 316320 | **Candidate Response:** 316316

203753 Quantitative Aptitude

Raise / View Objection

Two trains cross each other at a speed of 70 kmph and 50 kmph, respectively. If the total length of both the trains is 1500m, find the time in which they will cross each other. The trains were moving in the opposite direction.

316321	43 seconds
316322	41 seconds
316323	45 seconds
316324	49 seconds
316325	42 seconds

Correct Option: 316323 | **Candidate Response:** 316322

203754 Quantitative Aptitude

Raise / View Objection

		The speed of the stream is 25 kmph. The speed of the boat downstream is 15 m / s. Find the speed of the boat in still water. 316326: 8.06 m/s 316327: 6.05 m/s 316328: 5.23 m/s 316329: 7.05 m/s 316330: 8.56 m/s **Correct Option:** 316326 **Candidate Response:** 316328	
203755	Quantitative Aptitude	The speeds of a, b and c are 15 m / s, 67 kmph and 1020 m / minute. If they start running in the same direction, find the maximum difference between any two of them after 8 hours, 30 minutes and 39 seconds. 316331: 111.399 km 316332: 112.289 km 316333: 109.243 km 316334: 108.221 km 316335: 110.606 km **Correct Option:** 316335 **Candidate Response:** 316334	Raise / View Objection
203756	Quantitative Aptitude	5 men or 7 women can do a piece of work in 28 days. Find the time required by 7 men and 5 women to complete the task. 316336: 9 days	Raise / View Objection

	9 days
316337	13 days
316338	11 days
316339	12 days
316340	10 days

Correct Option: 316337	**Candidate Response:** 316337

203757 Quantitative Aptitude

Raise / View Objection

2 pipes can fill a tank in 10 minutes together. If the efficiency of the first pipe is 8 times the efficiency of the second pipe, find the time required to fill the tank using the second pipe alone.

316341	88 minutes
316342	87 minutes
316343	89 minutes
316344	90 minutes
316345	93 minutes

Correct Option: 316344	**Candidate Response:** 316341

203758 Quantitative Aptitude

Raise / View Objection

Find the ratio of investment of Ajay to Vijay if Ajay invests after 6 months of Vijay's investment and Vijay invests after 3 months of commencement of business. It is known that their profit – sharing ratio after 1 year of commencement of business is 2:3.

316346	2 : 1

316347	1 : 3
316348	3 : 1
316349	1 : 2
316350	4:1

Correct Option: 316346	**Candidate Response:** 316348

203759 Quantitative Aptitude

Raise / View Objection

A mixture contains milk and water in a ratio of 7: 11. When 7 liters of water is added, the ratio changes to 7: 13. Find the quantity of milk in the initial mixture.

316351	23.5 liters
316352	24.8 liters
316353	22.4 liters
316354	24.5 liters
316355	25.3 liters

Correct Option: 316354	**Candidate Response:** 316353

203760 Quantitative Aptitude

Raise / View Objection

The cost price of an article is twice the discount. If the discount is 40% of the selling price, find the profit or loss percent.

316356	25% loss
316357	25% profit
316358	20% loss

316359	20% profit
316360	30% profit

Correct Option: 316357	**Candidate Response:** 316359

203761 Quantitative Aptitude

Raise / View Objection

There are 1450 cars in the factory. The factory produces 8 cars hourly. If the sales of the factory are 80 cars per day, what will be the sale percentage to the total cars held by the factory after 7 days. It is known that the factory runs 8 hours daily.

316361	28.60 %
316362	27.50 %
316363	29.50 %
316364	24.54 %
316365	26.74 %

Correct Option: 316363	**Candidate Response:** 316363

203762 Quantitative Aptitude

Raise / View Objection

There are two children named p and q. If it is known that the ages of p and q are in a ratio of 4:20, and the sum of their ages is 10 years and 6 months. Find the age of q.

316366	5 years
316367	8 years
316368	4 years
316369	7 years

	7 years
316370	6 years

Correct Option: 316369	**Candidate Response:** 316366

203763 Quantitative Aptitude

Raise / View Objection

The average runs scored by 3 players is 160 per match. Their runs are in a ratio 4:6:2. What will be the average if the player who scored the minimum runs hits a century in the next match and the other two play with the same runs?

316371	160.50
316372	166.66
316373	162.50
316374	168.50
316375	164.50

Correct Option: 316372	**Candidate Response:** 316371

203764 Quantitative Aptitude

Raise / View Objection

One-third of the sum of all prime numbers greater than 2 but less than 20, is the square of which number?

316376	5
316377	6
316378	7
316379	8
316380	9

		Correct Option: 316376 **Candidate Response:** 316378	
203765	Quantitative Aptitude	Village P has a population of 78000, which is decreasing at the rate of 1800 per year. Village Q has a population of 54000, which is increasing at the rate of 600 per year. In how many years will the population of the two villages be equal? 316381: 14 316382: 15 316383: 10 316384: 12 316385: 13 **Correct Option:** 316383 **Candidate Response:** 316382	Raise / View Objection
203766	Quantitative Aptitude	What is the value of [26 + {42(23 – 20) + 2 – (2(5*80 – 100)) + 16 – 4}]? 316386: -434 316387: 434 316388: -443 316389: -453 316390: 435 **Correct Option:** 316386 **Candidate Response:** 316387	Raise / View Objection
203767	Quantitative Aptitude		

Find the value of $2a^3-[3a^3+4a^2-\{2a^3-7a^3\}+5a^3-7a^2]$.

316391	$-11a^3+3a^2$
316392	$7a^2+3a^3$
316393	$11a^3-3a^2$
316394	$-11a^3-3a^2$
316395	$11a^3-2a^2$

Correct Option: 316391 | **Candidate Response:** 316393

Raise / View Objection

203768 Quantitative Aptitude

A drum of kerosene is 3/4 full. When 50 liters of kerosene is drawn from it, it remains 11/16 full. What is the capacity of the drum?

316396	900 liters
316397	750 liters
316398	800 liters
316399	850 liters
316400	875 liters

Correct Option: 316398 | **Candidate Response:** 316397

Raise / View Objection

203769 Quantitative Aptitude

Raise / View Objection

Sujit and Suraj each have some money. If Sujit gives Rs.10 to Suraj, then Suraj will have twice the money left with Sujit. But, if Suraj gives Rs.10 to Sujit, then they both have an equal amount of money. How much money does Sujit have?

316401	Rs.70
316402	Rs.80
316403	Rs.60
316404	Rs.50
316405	Rs.40

Correct Option: 316404 | **Candidate Response:** 316404

203770 Quantitative Aptitude

Raise / View Objection

Find the value of $0.081^3+0.009^3+0.002187*0.09$.

316406	0.000729
316407	0.00729
316408	0.0000729
316409	0.0729
316410	0.729

Correct Option: 316406 | **Candidate Response:** 316408

203771 Quantitative Aptitude

Raise / View Objection

A sum of Rs. 8.75 is made up of 105 coins, which are either 10 paise or 5 paise. How many 5 paise coins are there?

316411

316411	40
316412	38
316413	37
316414	39
316415	35

Correct Option: 316415 | **Candidate Response:** 316413

203772 | Quantitative Aptitude

Raise / View Objection

Find the HCF of 405, 585, 765 and 900.

316416	45
316417	90
316418	35
316419	15
316420	50

Correct Option: 316416 | **Candidate Response:** 316418

203773 | Quantitative Aptitude

Raise / View Objection

Akshay has completely put each of three liquids, 558 liters of petrol, 682 liters of diesel and 589 liters of kerosene in bottles of equal size without mixing with any of the above three types of liquids such that each bottle is completely filled. What is the least possible number of bottles required?

316421	56

316422	59
316423	63
316424	66
316425	60

Correct Option: 316422 | **Candidate Response:** 316423

203774 | Quantitative Aptitude

Raise / View Objection

Three runners, Harshad, Aniket, and Rajesh, running around a circular track can complete one revolution in 12, 18 and 24 minutes respectively. After how many minutes will they meet at the starting point?

316426	70
316427	73
316428	75
316429	72
316430	76

Correct Option: 316429 | **Candidate Response:** 316428

203775 | Quantitative Aptitude

Raise / View Objection

Three wheels can complete 25, 21 and 16 revolutions per minute respectively. There is a red spot on each wheel that touches the ground at time zero. After how much time, all these spots will simultaneously touch the ground again?

316431	58 seconds
316432	60 seconds
316433	62 seconds

316434	59 seconds
316435	61 seconds

Correct Option: 316432 | **Candidate Response:** 316432

203776 Quantitative Aptitude

Raise / View Objection

If X, Y and Z are three numbers, such that LCM of X and Y is X and LCM of Y and Z is Y, then find the HCF of X, Y and Z.

316436	X
316437	Y
316438	Z
316439	XY
316440	YZ

Correct Option: 316438 | **Candidate Response:** 316438

203777 Quantitative Aptitude

Raise / View Objection

How many prime numbers are less than 100?

316441	20
316442	22
316443	24
316444	25
316445	23

		Correct Option: 316444 **Candidate Response:** 316442	
203778	Quantitative Aptitude	Find the sum of first 100 even natural numbers. 316446: 10100 316447: 11020 316448: 10080 316449: 10050 316450: 10070 **Correct Option:** 316446 **Candidate Response:** 316449	Raise / View Objection
203779	Quantitative Aptitude	In how many ways the number 3234 can be written as the product of two numbers which are co-prime to each other? 316451: 7 316452: 9 316453: 8 316454: 10 316455: 11 **Correct Option:** 316453 **Candidate Response:** 316455	Raise / View Objection
203780	Quantitative Aptitude	Given that, $1^2+3^2+5^2+7^2+9^2=165$, then what is the value of $3^2+9^2+15^2+21^2+27^2$?	Raise / View Objection

316456	1485
316457	1385
316458	990
316459	495
316460	995

Correct Option: 316456 | **Candidate Response:** 316458

203781	Quantitative Aptitude	Find the square root of $4a^2 + 9b^2 + c^2 + 12ab - 6bc - 4ac$.	Raise / View Objection

316461	2a + b – 3c
316462	2a – 3b – c
316463	2a – 3b + c
316464	2a + 3b – c
316465	2a +b- 2c

Correct Option: 316464 | **Candidate Response:** 316462

203782	Quantitative Aptitude	If x + y + z = 0, then what is the value of (x + y)(y + z)(z + x) ?	Raise / View Objection

316466	$x^2 + y^2 + z^2$
316467	$(x + y + z)^2$
316468	-xyz
316469	

	xyz
316470	$(x + y + z)^3$

Correct Option: 316468	**Candidate Response:** 316467

203783 Quantitative Aptitude

Raise / View Objection

How many numbers are there in between 55 and 3815, which are multiples of 5 and divisible by 3?

316471	249
316472	250
316473	251
316474	252
316475	238

Correct Option: 316473	**Candidate Response:** 316473

203784 Quantitative Aptitude

Raise / View Objection

The sum of 3 numbers in AP is 48. The sum of their squares is 800. Find the smallest number among the three numbers.

316476	10
316477	12
316478	11
316479	9
316480	13

Correct Option: 316477	**Candidate Response:** 316480

203785	Quantitative Aptitude	Find the product of 968427 and 3493. 316481: 3382715511 316482: 3382715523 316483: 3382756879 316484: 3382778965 316485: 3357729673 **Correct Option:** 316481 **Candidate Response:** 316484	Raise / View Objection
203786	Quantitative Aptitude	On dividing 30879 by a certain number, the quotient is 67 and the remainder is 327. Find the divisor. 316486: 476 316487: 456 316488: 466 316489: 444 316490: 457 **Correct Option:** 316487 **Candidate Response:** 316488	Raise / View Objection
203787	Quantitative Aptitude	Find the remainder when $354^{176} - 346^{176}$ is divided by 700. 316491: 5	Raise / View Objection

316492	0
316493	2
316494	4
316495	3

Correct Option: 316492 | **Candidate Response:** 316492

203788 Quantitative Aptitude

Raise / View Objection

How many factors of 19! are there, whose unit digit is 5?

316496	1298
316497	1296
316498	1295
316499	1297
316500	1291

Correct Option: 316497 | **Candidate Response:** 316499

203789 Quantitative Aptitude

Raise / View Objection

What number will replace A, if 3313A is divisible by 33?

316501	4
316502	5
316503	2
316504	6

316505	8

Correct Option: 316503	**Candidate Response:** 316504

203790 Quantitative Aptitude

Raise / View Objection

Which of the following divides $3^{45}+3^{46}+3^{47}+3^{48}+3^{49}$?

316506	3
316507	5
316508	2
316509	11
316510	4

Correct Option: 316509	**Candidate Response:** 316508

203791 Verbal Ability

Raise / View Objection

In this question, four words are given in bold. One of these words given in bold may be wrongly spelt or inappropriate. In the context of the sentence. Find out the word that is inappropriately or wrongly spelt, if any. That word is your answer. If all the words given in bold are correctly spelt or appropriate in the context of the sentence, then mark 'All correct' as your answer.

The book is **full** of **updated** and **contemparary commentary**.

316511	full
316512	updated
316513	contemparary
316514	commentary
316515	All correct

Correct Option: 316513	**Candidate Response:** 316515

203792 Verbal Ability

Raise / View Objection

In this question, four words are given in bold. One of these words given in bold may be wrongly spelt or inappropriate. In the context of the sentence. Find out the word that is inappropriately or wrongly spelt, if any. That word is your answer. If all the words given in bold are correctly spelt or appropriate in the context of the sentence, then mark 'All correct' as your answer.

We are now facing **stiff competing** from foreign companies **manufacturing similar** products.

316516	stiff
316517	competing
316518	manufacturing
316519	similar
316520	All correct

Correct Option: 316517	**Candidate Response:** 316517

203793 Verbal Ability

Raise / View Objection

In this question, four words are given in bold. One of these words given in bold may be wrongly spelt or inappropriate. In the context of the sentence. Find out the word that is inappropriately or wrongly spelt, if any. That word is your answer. If all the words given in bold are correctly spelt or appropriate in the context of the sentence, then mark 'All correct' as your answer.

Small **industries** in India are **facing huge presure.**

316521	industries
316522	facing
316523	

316523	huge
316524	presure
316525	All correct

Correct Option: 316524	**Candidate Response:** 316524

203794 Verbal Ability

Raise / View Objection

In this question, four words are given in bold. One of these words given in bold may be wrongly spelt or inappropriate. In the context of the sentence. Find out the word that is inappropriately or wrongly spelt, if any. That word is your answer. If all the words given in bold are correctly spelt or appropriate in the context of the sentence, then mark 'All correct' as your answer.

Another **benefit** is that **technology** can be quickly **adapted** to client's **needs**.

316526	benefit
316527	Technology
316528	adapted
316529	needs
316530	All correct

Correct Option: 316530	**Candidate Response:** 316530

203795 Verbal Ability

In this question, four words are given in bold. One of these words given in bold may be wrongly spelt or inappropriate. In the context of the sentence. Find out the word that is inappropriately or wrongly spelt, if any. That word is your answer. If all the words given in bold are correctly spelt or appropriate in the context of the sentence, then mark 'All correct' as your answer.

Traditionlly sales get a **boost** in the **festival season**.

316531	Traditionlly
316532	boost
316533	festival
316534	season
316535	all correct

Correct Option: 316531	**Candidate Response:** 316531

Raise / View Objection

203796	Verbal Ability		Raise / View Objection

Read the following passage carefully and answer the questions that follow.

There is now no denying that the new government takes office amid a clear economic slowdown. The first macro data set released showed an under-performing economy with GDP growth falling to 5.8% in the fourth quarter of 2018-19 and pulling down the overall growth for the fiscal to a five-year low of 6.8%. Growth in gross value added (GVA), which is GDP minus taxes and subsidies, fell to 6.6% in 2018-19, pointing to a serious slowdown. If further confirmation were needed, the growth in core sector output — a set of eight major industrial sectors — fell to 2.6% in April, compared to 4.7% in the same month last year. And finally, unemployment data, controversially suppressed by the Union government so far, showed that joblessness was at a 45-year high of 6.1% in 2017-18. These numbers highlight the challenges ahead in drafting the Budget for 2019-20. The economy is beset by a consumption slowdown as reflected in the falling sales of everything from automobiles to consumer durables, even fast-moving consumer goods. Private investment is not taking off, while government spending, which kept the economy afloat during the last NDA government, was cut back in the last quarter of 2018-19 to meet the fiscal deficit target of 3.4%. The good news is that inflation is undershooting the target and oil prices are on the retreat again. But the rural economy remains in distress, as seen by the 2.9% growth in agriculture last fiscal; the sector needs a good monsoon this year to bounce back. Overall economic growth in the first quarter of this fiscal is likely to remain subdued, and any improvement is unlikely until the late second quarter or the early third. There are not too many options before the new Finance Minister. In the near term, she has to boost consumption, which means putting more money in the hands of people. That, in turn, means cutting taxes, which is not easy given the commitment to rein in the fiscal deficit. In the medium term, Ms. Sitharaman has to take measures to boost private investment even as she opens up public spending again. These call for major reforms, starting with land acquisition and labour, corporate taxes by reducing exemptions and dropping rates, and nursing banks back to health. On the table will be options such as further recapitalisation of the ailing banks, and consolidation. The question, though, is where the money will come from. With tax revenues likely to be subdued owing to the slowdown, the Centre will have to look at alternative sources such as disinvestment. There may be little choice but to go big on privatisation. A rate cut by the Reserve Bank of India, widely expected this week, would certainly help boost sentiment. But it is the Budget that will really set the tone for the economy.

Which of the following is the closest in meaning to the word beset?

316536	Besiege
316537	Terminate

	Terminate
316538	Filter
316539	Tiny
316540	Huge

Correct Option: 316536	**Candidate Response:** 316537

203797	Verbal Ability		Raise / View Objection

Read the following passage carefully and answer the questions that follow.

There is now no denying that the new government takes office amid a clear economic slowdown. The first macro data set released showed an under-performing economy with GDP growth falling to 5.8% in the fourth quarter of 2018-19 and pulling down the overall growth for the fiscal to a five-year low of 6.8%. Growth in gross value added (GVA), which is GDP minus taxes and subsidies, fell to 6.6% in 2018-19, pointing to a serious slowdown. If further confirmation were needed, the growth in core sector output — a set of eight major industrial sectors — fell to 2.6% in April, compared to 4.7% in the same month last year. And finally, unemployment data, controversially suppressed by the Union government so far, showed that joblessness was at a 45-year high of 6.1% in 2017-18. These numbers highlight the challenges ahead in drafting the Budget for 2019-20. The economy is beset by a consumption slowdown as reflected in the falling sales of everything from automobiles to consumer durables, even fast-moving consumer goods. Private investment is not taking off, while government spending, which kept the economy afloat during the last NDA government, was cut back in the last quarter of 2018-19 to meet the fiscal deficit target of 3.4%. The good news is that inflation is undershooting the target and oil prices are on the retreat again. But the rural economy remains in distress, as seen by the 2.9% growth in agriculture last fiscal; the sector needs a good monsoon this year to bounce back. Overall economic growth in the first quarter of this fiscal is likely to remain subdued, and any improvement is unlikely until the late second quarter or the early third. There are not too many options before the new Finance Minister. In the near term, she has to boost consumption, which means putting more money in the hands of people. That, in turn, means cutting taxes, which is not easy given the commitment to rein in the fiscal deficit. In the medium term, Ms. Sitharaman has to take measures to boost private investment even as she opens up public spending again. These call for major reforms, starting with land acquisition and labour, corporate taxes by reducing exemptions and dropping rates, and nursing banks back to health. On the table will be options such as further recapitalisation of the ailing banks, and consolidation. The question, though, is where the money will come from. With tax revenues likely to be subdued owing to the slowdown, the Centre will have to look at alternative sources such as disinvestment. There may be little choice but to go big on privatisation. A rate cut by the Reserve Bank of India, widely expected this week, would certainly help boost sentiment. But it is the Budget that will really set the tone for the economy.

Which of the following is / are true as per the passage?

I. There is going to be a definite rate cut by the RBI in the coming week.

II. The rural economy is in better shape than the urban economy.

III. Government spending has increased in the last quarter of 2018-19.

316541	Only II
316542	Only I and II
316543	Only I and III
316544	Only II and III
316545	Not any of the above

Correct Option: 316545	**Candidate Response:** 316543

203798	Verbal Ability		Raise / View Objection

Read the following passage carefully and answer the questions that follow.

There is now no denying that the new government takes office amid a clear economic slowdown. The first macro data set released showed an under-performing economy with GDP growth falling to 5.8% in the fourth quarter of 2018-19 and pulling down the overall growth for the fiscal to a five-year low of 6.8%. Growth in gross value added (GVA), which is GDP minus taxes and subsidies, fell to 6.6% in 2018-19, pointing to a serious slowdown. If further confirmation were needed, the growth in core sector output — a set of eight major industrial sectors — fell to 2.6% in April, compared to 4.7% in the same month last year. And finally, unemployment data, controversially suppressed by the Union government so far, showed that joblessness was at a 45-year high of 6.1% in 2017-18. These numbers highlight the challenges ahead in drafting the Budget for 2019-20. The economy is beset by a consumption slowdown as reflected in the falling sales of everything from automobiles to consumer durables, even fast-moving consumer goods. Private investment is not taking off, while government spending, which kept the economy afloat during the last NDA government, was cut back in the last quarter of 2018-19 to meet the fiscal deficit target of 3.4%. The good news is that inflation is undershooting the target and oil prices are on the retreat again. But the rural economy remains in distress, as seen by the 2.9% growth in agriculture last fiscal; the sector needs a good monsoon this year to bounce back. Overall economic growth in the first quarter of this fiscal is likely to remain subdued, and any improvement is unlikely until the late second quarter or the early third. There are not too many options before the new Finance Minister. In the near term, she has to boost consumption, which means putting more money in the hands of people. That, in turn, means cutting taxes, which is not easy given the commitment to rein in the fiscal deficit. In the medium term, Ms. Sitharaman has to take measures to boost private investment even as she opens up public spending again. These call for major reforms, starting with land acquisition and labour, corporate taxes by reducing exemptions and dropping rates, and nursing banks back to health. On the table will be options such as further recapitalisation of the ailing banks, and consolidation. The question, though, is where the money will come from. With tax revenues likely to be subdued owing to the slowdown, the Centre will have to look at alternative sources such as disinvestment. There may be little choice but to go big on privatisation. A rate cut by the Reserve Bank of India, widely expected this week, would certainly help boost sentiment. But it is the Budget that will really set the tone for the economy.

Which of the following, as per the passage, indicates a slowdown in the Indian economy?

I. Fall in sale levels of consumer durables

II. Negative growth in the core sector output

III. Fall in inflations levels

316546	Only I
316547	Only III
316548	Only II
316549	Only I and II
316550	All I , II and III

Correct Option: 316546	**Candidate Response:** 316547

203799	Verbal Ability		Raise / View Objection

Read the following passage carefully and answer the questions that follow.

There is now no denying that the new government takes office amid a clear economic slowdown. The first macro data set released showed an under-performing economy with GDP growth falling to 5.8% in the fourth quarter of 2018-19 and pulling down the overall growth for the fiscal to a five-year low of 6.8%. Growth in gross value added (GVA), which is GDP minus taxes and subsidies, fell to 6.6% in 2018-19, pointing to a serious slowdown. If further confirmation were needed, the growth in core sector output — a set of eight major industrial sectors — fell to 2.6% in April, compared to 4.7% in the same month last year. And finally, unemployment data, controversially suppressed by the Union government so far, showed that joblessness was at a 45-year high of 6.1% in 2017-18. These numbers highlight the challenges ahead in drafting the Budget for 2019-20. The economy is beset by a consumption slowdown as reflected in the falling sales of everything from automobiles to consumer durables, even fast-moving consumer goods. Private investment is not taking off, while government spending, which kept the economy afloat during the last NDA government, was cut back in the last quarter of 2018-19 to meet the fiscal deficit target of 3.4%. The good news is that inflation is undershooting the target and oil prices are on the retreat again. But the rural economy remains in distress, as seen by the 2.9% growth in agriculture last fiscal; the sector needs a good monsoon this year to bounce back. Overall economic growth in the first quarter of this fiscal is likely to remain subdued, and any improvement is unlikely until the late second quarter or the early third. There are not too many options before the new Finance Minister. In the near term, she has to boost consumption, which means putting more money in the hands of people. That, in turn, means cutting taxes, which is not easy given the commitment to rein in the fiscal deficit. In the medium term, Ms. Sitharaman has to take measures to boost private investment even as she opens up public spending again. These call for major reforms, starting with land acquisition and labour, corporate taxes by reducing exemptions and dropping rates, and nursing banks back to health. On the table will be options such as further recapitalisation of the ailing banks, and consolidation. The question, though, is where the money will come from. With tax revenues likely to be subdued owing to the slowdown, the Centre will have to look at alternative sources such as disinvestment. There may be little choice but to go big on privatisation. A rate cut by the Reserve Bank of India, widely expected this week, would certainly help boost sentiment. But it is the Budget that will really set the tone for the economy.

As per the passage, which of the following would lead to 'putting more money in the hands of people'?

I. Decrease in tax rates.

II. Increase in inflation

III. Increase in private investment

316551	Only I
316552	Only III
316553	Only I and II
316554	Only I and III
316555	Only II

Correct Option: 316551	**Candidate Response:** 316551

203800	Verbal Ability		Raise / View Objection

Read the following passage carefully and answer the questions that follow.

There is now no denying that the new government takes office amid a clear economic slowdown. The first macro data set released showed an under-performing economy with GDP growth falling to 5.8% in the fourth quarter of 2018-19 and pulling down the overall growth for the fiscal to a five-year low of 6.8%. Growth in gross value added (GVA), which is GDP minus taxes and subsidies, fell to 6.6% in 2018-19, pointing to a serious slowdown. If further confirmation were needed, the growth in core sector output — a set of eight major industrial sectors — fell to 2.6% in April, compared to 4.7% in the same month last year. And finally, unemployment data, controversially suppressed by the Union government so far, showed that joblessness was at a 45-year high of 6.1% in 2017-18. These numbers highlight the challenges ahead in drafting the Budget for 2019-20. The economy is beset by a consumption slowdown as reflected in the falling sales of everything from automobiles to consumer durables, even fast-moving consumer goods. Private investment is not taking off, while government spending, which kept the economy afloat during the last NDA government, was cut back in the last quarter of 2018-19 to meet the fiscal deficit target of 3.4%. The good news is that inflation is undershooting the target and oil prices are on the retreat again. But the rural economy remains in distress, as seen by the 2.9% growth in agriculture last fiscal; the sector needs a good monsoon this year to bounce back. Overall economic growth in the first quarter of this fiscal is likely to remain subdued, and any improvement is unlikely until the late second quarter or the early third. There are not too many options before the new Finance Minister. In the near term, she has to boost consumption, which means putting more money in the hands of people. That, in turn, means cutting taxes, which is not easy given the commitment to rein in the fiscal deficit. In the medium term, Ms. Sitharaman has to take measures to boost private investment even as she opens up public spending again. These call for major reforms, starting with land acquisition and labour, corporate taxes by reducing exemptions and dropping rates, and nursing banks back to health. On the table will be options such as further recapitalisation of the ailing banks, and consolidation. The question, though, is where the money will come from. With tax revenues likely to be subdued owing to the slowdown, the Centre will have to look at alternative sources such as disinvestment. There may be little choice but to go big on privatisation. A rate cut by the Reserve Bank of India, widely expected this week, would certainly help boost sentiment. But it is the Budget that will really set the tone for the economy.

As per the passage, which of the following reforms has NOT been mentioned in the passage to improve the investment climate?

316556	Land acquisition

316557	Privatization of banks
316558	Adjustment in the prevailing Corporate Tax Rates
316559	Recapitalization of banks
316560	All are correct

Correct Option: 316557	**Candidate Response:** 316558

203801 Verbal Ability

Raise / View Objection

Which of the following sentences does not contribute to the main idea of the paragraph?

1. There is evidence that digital platforms of education are badly hurting less proficient students who need expert classroom teachers.
2. In the fully digital mode, students are never in the same room with their teacher, which leaves them to depend on self-study mode more.
3. A study showed that students on digital algebra courses learned much less than those who worked with a teacher in the classroom.
4. Digital courses have often been seen to give students an easy passing grade without teaching them important things which affect them in the long run.
5. Digital platforms are beneficial to high achievers by providing advanced courses for knowledge enhancement.

316561	1
316562	2
316563	3
316564	4
316565	5

		Correct Option: 316565	**Candidate Response:** 316562

203802	Verbal Ability	Which of the following sentences does not contribute to the main idea of the paragraph? 1. A new survey shows that Amazon Prime has grown much more beneficial than traditional television. 2. The streaming of television shows and the freedom of users to choose their own shows has taken off with people. 3. Amazon Prime provides a constantly improving content library which consists of many original series, films and comedy shows that keeps it in demand. 4. Amazon Prime provides a facility for people to personize their own favorites and pause live TV. 5. Despite the success of Amazon Prime, most investors are unaware of this company.	Raise / View Objection

316566	1
316567	2
316568	3
316569	4
316570	5

Correct Option: 316570	**Candidate Response:** 316570

203803	Verbal Ability		Raise / View Objection

		Which of the following sentences does not contribute to the main idea of the paragraph? 1. Climate change is threatening biodiversity. 2. Animals may struggle to survive as their habitats are disrupted. 3. Climate change is beneficial for species adaptation. 4. Rising temperatures are affecting ecosystems and habitats. 5. Species extinction is a risk due to climate change. 316571 — 1 316572 — 2 316573 — 3 316574 — 4 316575 — 5 **Correct Option:** 316573 **Candidate Response:** 316571	
203804	Verbal Ability	Which of the following sentences does not contribute to the main idea of the paragraph? 1. Social media changes how people interact with others. 2. People use social media to share experiences and ideas. 3. Social media has only positive effects on mental health. 4. Comparison on social media can lead to feelings of loneliness and anxiety. 5. Balancing online and real-life connections is important. 316576 — 1 316577 — 2 316578 — 3 316579 — 4	Raise / View Objection

316580	5

Correct Option: 316578	**Candidate Response:** 316576

203805 Verbal Ability

Raise / View Objection

Which of the following sentences does not contribute to the main idea of the paragraph?

1. Early childhood education contributes to academic and social success.

2. Quality preschool programs help develop communication and problem-solving skills.

3. Early education has little impact on a child's later success.

4. Foundational skills learned early are important for future success.

5. Early childhood education is vital for long-term academic achievement.

316581	1
316582	2
316583	3
316584	4
316585	5

Correct Option: 316583	**Candidate Response:** 316583

203806 Verbal Ability

Raise / View Objection

Direction: Read the following passage carefully and answer the following question.

The world population is living, working, vacationing, increasingly conglomerating along the coasts, and standing on the front row of the greatest, most unprecedented, plastic waste tide ever faced. Washed out on our coasts in obvious and clearly visible form, the plastic pollution spectacle blatantly unveiling on our beaches is only the prelude of the greater story that unfolded further away in the world's oceans, yet mostly originating from where we stand: the land. For more than 50 years, global production and consumption of plastics have continued to rise. An estimated 299 million tons of plastics were produced in 2013, representing a 4 percent increase over 2012, and confirming an upward trend over the past years. In 2008, our global plastic consumption worldwide has been estimated at 260 million tons, and, according to a 2012 report by Global Industry Analysts, plastic consumption is to reach 297.5 million tons by the end of 2015. Plastic is versatile, lightweight, flexible, moisture resistant, strong, and relatively inexpensive. Those are the attractive qualities that lead us, around the world, to such a voracious appetite and over-consumption of plastic goods. However, durable and very slow to degrade, plastic materials that are used in the production of so many products all, ultimately, become waste with staying power. Our tremendous attraction to plastic, coupled with an undeniable behavioural propensity of increasingly over-consuming, discarding, littering and thus polluting, has become a combination of lethal nature. A simple walk on any beach, anywhere, and the plastic waste spectacle is present. All over the world, the statistics are ever growing, staggeringly. Tons of plastic debris (which by definition are waste that can vary in size from large containers, fishing nets to microscopic plastic pellets or even particles) is discarded every year, everywhere, polluting lands, rivers, coasts, beaches, and oceans. Published in the journal Science in February 2015, a study conducted by a scientific working group at UC Santa Barbara's National Center for Ecological Analysis and Synthesis (NCEAS), quantified the input of plastic waste from land into the ocean. The results: every year, 8 million metric tons of plastic end up in our oceans. It's equivalent to five grocery bags filled with plastic for every foot of coastline in the world. In 2025, the annual input is estimated to be about twice greater, or 10 bags full of plastic per foot of coastline. So the cumulative input for 2025 would be nearly 20 times the 8 million metric tons estimate – 100 bags of plastic per foot of coastline in the world!

As per the passage, which of the following statements are true?

1. Most of the plastic present in the ocean today has originated from the land.

2. In recent years, the production of plastics has declined.

3. Plastic pollution is present on almost every beach.

316586

316586	Only 1
316587	Only 2
316588	None of 1, 2 and 3
316589	All 1, 2 and 3
316590	Only 1 and 3

Correct Option: 316590	**Candidate Response:** 316589

203807	Verbal Ability		Raise / View Objection

Direction: Read the following passage carefully and answer the following questions.

India is considering inviting expressions of interest to sell Air India Ltd by the end of next month as the government aims to complete the transaction this year, people with knowledge of the matter said. "The government will conduct roadshows, as well as, be open to meet prospective buyers even before the expressions of interest are sought," the people said, declining to be identified as the discussions are private. "The process will likely allow the bidders to look at the accounts of the airline except for some portions that are confidential and also see the share purchase agreement," they said without providing details. "The potential bidders will have the option to make suggestions for changes in the sale terms during the process of expressing their interest in the deal," the people said. The government is looking to sell its entire stake in the carrier, they said. DS Malik, a spokesman of the Ministry of Finance, did not immediately answer two calls made to his mobile phone. Dhananjay Kumar, a spokesman of Air India, declined to comment. The plan is being prepared after the government's attempt to partially exit the carrier failed to attract any bidder last year. In her budget presentation for the current financial year, Finance Minister Nirmala Sitharaman said that the government will revive plans to sell Air India and the divestment would be part of the government's efforts to raise Rs 1,05,000 crore ($15.3 billion) selling stakes in state-run companies. Air India, which is surviving on a Rs 30,000 crore taxpayer-funded bailout, has failed to maintain its market dominance as a slew of carriers including InterGlobe Aviation Ltd and SpiceJet Ltd started to offer ultra-cheap, on-time flights more than a decade ago. The state-run airline has total debts of $8.4 billion and posted losses of more than Rs 7,600 crore last year, according to provisional estimates.

Which among the following has been shown as the main reason for the present situation of Air India in the passage?

316591	Air India does not have enough money to survive in the long run though it is trying to find out.
316592	Air India has lost all the deposits it had received from the government last year.
316593	Air India is in the process of earning deposits from the depositors and investors so that they are worried about the stake sale.
316594	Air India has got competition from other airlines and it has simply failed to live up to the same.
316595	Not any of the above

	Not any of the above

Correct Option: 316591	**Candidate Response:** 316592

203808 Verbal Ability

Raise / View Objection

Direction: Read the following passage carefully and answer the following questions.

India is considering inviting expressions of interest to sell Air India Ltd by the end of next month as the government aims to complete the transaction this year, people with knowledge of the matter said. "The government will conduct roadshows, as well as, be open to meet prospective buyers even before the expressions of interest are sought," the people said, declining to be identified as the discussions are private. "The process will likely allow the bidders to look at the accounts of the airline except for some portions that are confidential and also see the share purchase agreement," they said without providing details. "The potential bidders will have the option to make suggestions for changes in the sale terms during the process of expressing their interest in the deal," the people said. The government is looking to sell its entire stake in the carrier, they said. DS Malik, a spokesman of the Ministry of Finance, did not immediately answer two calls made to his mobile phone. Dhananjay Kumar, a spokesman of Air India, declined to comment. The plan is being prepared after the government's attempt to partially exit the carrier failed to attract any bidder last year. In her budget presentation for the current financial year, Finance Minister Nirmala Sitharaman said that the government will revive plans to sell Air India and the divestment would be part of the government's efforts to raise Rs 1,05,000 crore ($15.3 billion) selling stakes in state-run companies. Air India, which is surviving on a Rs 30,000 crore taxpayer-funded bailout, has failed to maintain its market dominance as a slew of carriers including InterGlobe Aviation Ltd and SpiceJet Ltd started to offer ultra-cheap, on-time flights more than a decade ago. The state-run airline has total debts of $8.4 billion and posted losses of more than Rs 7,600 crore last year, according to provisional estimates.

Which among the following is OPPOSITE in meaning to the word Dominance as used in the passage?

316596	Inferiority
316597	Powerlessness
316598	Submission
316599	Ascendancy

316600	Not any of the above

Correct Option: 316596	**Candidate Response:** 316596

203809 Verbal Ability

Raise / View Objection

Read the following passage carefully and answer the questions given below.

The second-largest colony of emperor penguins in the world appears to be collapsing, after rough seas drowned all of its babies three winters in a row. The Halley Bay colony once accounted for 5 to 9% of the global emperor penguin population, according to the British Antarctic Survey (BAC), which reported the catastrophe. That amounted to about 15,000 to 24,000 adult breeding pairs. But in 2016, the sea-ice platform on which the colony was raising its babies collapsed during rough weather, throwing infant penguins unable to swim into the frigid water. In 2017 and 2018, the rough weather pattern repeated itself. The birds arrive at the site from their summer sea jaunts each April to breed; for the resulting chicks to survive, the site has to remain stable throughout the Southern Hemisphere's winter, which lasts until December. By 2018, a handful of adults — a "few hundred," or about 2 percent of the original population — turned up at the Halley Bay site, the researchers reported. The remaining colony appeared in disarray, with adults moving closer to the ice edge than is typical, and was difficult to count scattered among the roughened chunks of ice. The good news is that at least some of the colony appears to have moved, rather than died out. The Dawson[1]Lambton Glacier colony 34 miles (55 kilometers) to the south has significantly swelled in numbers since the devastation of Halley Bay, the BAC reported. That colony, which had hit a low of just 1,280 pairs in the 2015 season, swelled in each succeeding year. In 2016, it reached 5,315 pairs. In 2017, there were 11,117 pairs. And by 2018, a full 14,612 pairs set up camp at the site.

Which of the following is an antonym of "frigid" in the context of passage?

316601	Flexible
316602	Soft
316603	Lukewarm
316604	Rigid
316605	Hot

Correct Option: 316605	**Candidate Response:** 316605	

203810	Verbal Ability		Raise / View Objection

Read the following passage carefully and answer the questions given below.

The second-largest colony of emperor penguins in the world appears to be collapsing, after rough seas drowned all of its babies three winters in a row. The Halley Bay colony once accounted for 5 to 9% of the global emperor penguin population, according to the British Antarctic Survey (BAC), which reported the catastrophe. That amounted to about 15,000 to 24,000 adult breeding pairs. But in 2016, the sea-ice platform on which the colony was raising its babies collapsed during rough weather, throwing infant penguins unable to swim into the frigid water. In 2017 and 2018, the rough weather pattern repeated itself. The birds arrive at the site from their summer sea jaunts each April to breed; for the resulting chicks to survive, the site has to remain stable throughout the Southern Hemisphere's winter, which lasts until December. By 2018, a handful of adults — a "few hundred," or about 2 percent of the original population — turned up at the Halley Bay site, the researchers reported. The remaining colony appeared in disarray, with adults moving closer to the ice edge than is typical, and was difficult to count scattered among the roughened chunks of ice. The good news is that at least some of the colony appears to have moved, rather than died out. The Dawson[1]Lambton Glacier colony 34 miles (55 kilometers) to the south has significantly swelled in numbers since the devastation of Halley Bay, the BAC reported. That colony, which had hit a low of just 1,280 pairs in the 2015 season, swelled in each succeeding year. In 2016, it reached 5,315 pairs. In 2017, there were 11,117 pairs. And by 2018, a full 14,612 pairs set up camp at the site.

Which of the following is false in the context of the passage?

I. The Dawson-Lambton Glacier colony died due to collapse of rough sea.

II. The penguin birds breed during April every year.

III. Halley Bay colony reached 5315 pairs in 2016.

316606	Only I
316607	Only II
316608	Only I and III
316609	Only II and III
316610	All I, II and III

		Correct Option: 316608 **Candidate Response:** 316607	
203811	Verbal Ability		Raise / View Objection

Read the passage and answer the questions that follow:

Once upon a time, there lived a farmer who had a little land. His name was Tuan, and he was a very kind and good-natured person. He lived in a hut on his land with his wife and children and earned by selling whatever crops he could produce on his small land. Tuan loved to help others. Whenever someone fell ill or needed something badly, Tuan was there to help that person. If someone died in the village, Tuan assisted the family members of the deceased person in whichever way he could. If anyone fell ill at night, Tuan was right beside the village doctor to help him prepare the medicines and tend to the sick. There seemed to be none who hated this man. He appeared to be loved by one and all. But there was one person who hated Tuan with all his heart. He was Juan, a neighbour of Tuan, who lived in the land next to him. A lazy person by nature, Juan hardly put in as much effort to cultivate his land as Tuan did to produce crops in his own. So, when the harvest season arrived every year, Juan found that he had very few crops to sell. Tuan, on the other hand, earned a handsome profit through the selling of his produces. One year, Juan could no longer contain his jealousy. Just days before Tuan was to reap his harvest, Juan set fire to his crops at night. Tuan was asleep at this time, and it was only the alertness of one of his other neighbors that saved much of his crops from being perished in the deadly flames of the fire that Juan had lighted. When the flames were doused, Tuan saw which direction the fire had started from. Juan's animosity towards him was unknown to Tuan. But he let the matters rest and decided to take action only if he saw Juan repeating his dastardly act once again. That year, Tuan managed to sell the rest of his crops at a good price, but he could not make much profit for a good part of his produces had been burnt. He had a heavy heart, but he did not like to tell anyone about it. Only days later, Tuan was awakened by the sound of lamentations. He went out to find a crowd beside Juan's hut. He rushed to find that Juan's son had fallen ill. He found that the village doctor was unable to provide a cure to his illness. Tuan knew what he had to do. He untied his own horse and rode it. Then he rushed to the town that was ten miles away and fetched a more experienced doctor who lived there. This doctor was able to guess the disease correctly and provided an exact cure for it. Within hours, the boy was found to sleep soundly and Tuan went with the doctor to take him back to the town. A day later, Juan went to Tuan's hut and began to weep bitterly. He confessed to his sins but was surprised when Tuan told him that he knew about it all. "You knew that I had set fire to your crops? And still you fetched the doctor for my son?" asked the astonished Juan. Tuan nodded and said, "I did what I knew was right. Could I do wrong just because you had done so?" Juan stood up and embraced Tuan. Both men were in tears and so were the others who stood by them. From that day, Juan changed himself. Within a year, he could produce much crops in his land through his hard work. When the others asked him how he had changed so much, he only replied, "It was the goodness and love of Tuan that transformed me."

Which of the following is/are true about Tuan?

I. He was a doctor along with being a farmer.

II. He was a good-natured and kind person.

III. He was a wealthy farmer who gave away his wealth to the needy.

316611	Only I
316612	Only II
316613	Only I and III
316614	Only II and III
316615	All I, II and III

Correct Option: 316612	**Candidate Response:** 316611

203812	Verbal Ability		Raise / View Objection

Read the passage and answer the questions that follow:

Once upon a time, there lived a farmer who had a little land. His name was Tuan, and he was a very kind and good-natured person. He lived in a hut on his land with his wife and children and earned by selling whatever crops he could produce on his small land. Tuan loved to help others. Whenever someone fell ill or needed something badly, Tuan was there to help that person. If someone died in the village, Tuan assisted the family members of the deceased person in whichever way he could. If anyone fell ill at night, Tuan was right beside the village doctor to help him prepare the medicines and tend to the sick. There seemed to be none who hated this man. He appeared to be loved by one and all. But there was one person who hated Tuan with all his heart. He was Juan, a neighbour of Tuan, who lived in the land next to him. A lazy person by nature, Juan hardly put in as much effort to cultivate his land as Tuan did to produce crops in his own. So, when the harvest season arrived every year, Juan found that he had very few crops to sell. Tuan, on the other hand, earned a handsome profit through the selling of his produces. One year, Juan could no longer contain his jealousy. Just days before Tuan was to reap his harvest, Juan set fire to his crops at night. Tuan was asleep at this time, and it was only the alertness of one of his other neighbors that saved much of his crops from being perished in the deadly flames of the fire that Juan had lighted. When the flames were doused, Tuan saw which direction the fire had started from. Juan's animosity towards him was unknown to Tuan. But he let the matters rest and decided to take action only if he saw Juan repeating his dastardly act once again. That year, Tuan managed to sell the rest of his crops at a good price, but he could not make much profit for a good part of his produces had been burnt. He had a heavy heart, but he did not like to tell anyone about it. Only days later, Tuan was awakened by the sound of lamentations. He went out to find a crowd beside Juan's hut. He rushed to find that Juan's son had fallen ill. He found that the village doctor was unable to provide a cure to his illness. Tuan knew what he had to do. He untied his own horse and rode it. Then he rushed to the town that was ten miles away and fetched a more experienced doctor who lived there. This doctor was able to guess the disease correctly and provided an exact cure for it. Within hours, the boy was found to sleep soundly and Tuan went with the doctor to take him back to the town. A day later, Juan went to Tuan's hut and began to weep bitterly. He confessed to his sins but was surprised when Tuan told him that he knew about it all. "You knew that I had set fire to your crops? And still you fetched the doctor for my son?" asked the astonished Juan. Tuan nodded and said, "I did what I knew was right. Could I do wrong just because you had done so?" Juan stood up and embraced Tuan. Both men were in tears and so were the others who stood by them. From that day, Juan changed himself. Within a year, he could produce much crops in his land through his hard work. When the others asked him how he had changed so much, he only replied, "It was the goodness and love of Tuan that transformed me."

Which of the following is/are a/some ways in which Juan transformed himself?

I. He began to work hard on his crops.

II. He became more helpful towards people.

III. He started a small charity in Tuan's name.

316616	Only I
316617	Only III
316618	Only I and II
316619	Only II and III
316620	All I, II and III

Correct Option: 316616	**Candidate Response:** 316618

203813	Verbal Ability		Raise / View Objection

Read the passage and answer the questions that follow:

Once upon a time, there lived a farmer who had a little land. His name was Tuan, and he was a very kind and good-natured person. He lived in a hut on his land with his wife and children and earned by selling whatever crops he could produce on his small land. Tuan loved to help others. Whenever someone fell ill or needed something badly, Tuan was there to help that person. If someone died in the village, Tuan assisted the family members of the deceased person in whichever way he could. If anyone fell ill at night, Tuan was right beside the village doctor to help him prepare the medicines and tend to the sick. There seemed to be none who hated this man. He appeared to be loved by one and all. But there was one person who hated Tuan with all his heart. He was Juan, a neighbour of Tuan, who lived in the land next to him. A lazy person by nature, Juan hardly put in as much effort to cultivate his land as Tuan did to produce crops in his own. So, when the harvest season arrived every year, Juan found that he had very few crops to sell. Tuan, on the other hand, earned a handsome profit through the selling of his produces. One year, Juan could no longer contain his jealousy. Just days before Tuan was to reap his harvest, Juan set fire to his crops at night. Tuan was asleep at this time, and it was only the alertness of one of his other neighbors that saved much of his crops from being perished in the deadly flames of the fire that Juan had lighted. When the flames were doused, Tuan saw which direction the fire had started from. Juan's animosity towards him was unknown to Tuan. But he let the matters rest and decided to take action only if he saw Juan repeating his dastardly act once again. That year, Tuan managed to sell the rest of his crops at a good price, but he could not make much profit for a good part of his produces had been burnt. He had a heavy heart, but he did not like to tell anyone about it. Only days later, Tuan was awakened by the sound of lamentations. He went out to find a crowd beside Juan's hut. He rushed to find that Juan's son had fallen ill. He found that the village doctor was unable to provide a cure to his illness. Tuan knew what he had to do. He untied his own horse and rode it. Then he rushed to the town that was ten miles away and fetched a more experienced doctor who lived there. This doctor was able to guess the disease correctly and provided an exact cure for it. Within hours, the boy was found to sleep soundly and Tuan went with the doctor to take him back to the town. A day later, Juan went to Tuan's hut and began to weep bitterly. He confessed to his sins but was surprised when Tuan told him that he knew about it all. "You knew that I had set fire to your crops? And still you fetched the doctor for my son?" asked the astonished Juan. Tuan nodded and said, "I did what I knew was right. Could I do wrong just because you had done so?" Juan stood up and embraced Tuan. Both men were in tears and so were the others who stood by them. From that day, Juan changed himself. Within a year, he could produce much crops in his land through his hard work. When the others asked him how he had changed so much, he only replied, "It was the goodness and love of Tuan that transformed me."

What did Tuan do when he discovered Juan's son was ill?		
316621	He called the village doctor who lived a few houses away.	
316622	He went back to his house thinking Juan deserved what he got.	
316623	He rode out to the nearest hospital along with Juan's son to get him treated.	
316624	He went back to his house to get some medicines which could help Juan's son	
316625	He rode to the nearest town to get a better doctor.	

Correct Option: 316625	**Candidate Response:** 316624

203814	Verbal Ability		Raise / View Objection

Read the passage and answer the questions that follow:

Once upon a time, there lived a farmer who had a little land. His name was Tuan, and he was a very kind and good-natured person. He lived in a hut on his land with his wife and children and earned by selling whatever crops he could produce on his small land. Tuan loved to help others. Whenever someone fell ill or needed something badly, Tuan was there to help that person. If someone died in the village, Tuan assisted the family members of the deceased person in whichever way he could. If anyone fell ill at night, Tuan was right beside the village doctor to help him prepare the medicines and tend to the sick. There seemed to be none who hated this man. He appeared to be loved by one and all. But there was one person who hated Tuan with all his heart. He was Juan, a neighbour of Tuan, who lived in the land next to him. A lazy person by nature, Juan hardly put in as much effort to cultivate his land as Tuan did to produce crops in his own. So, when the harvest season arrived every year, Juan found that he had very few crops to sell. Tuan, on the other hand, earned a handsome profit through the selling of his produces. One year, Juan could no longer contain his jealousy. Just days before Tuan was to reap his harvest, Juan set fire to his crops at night. Tuan was asleep at this time, and it was only the alertness of one of his other neighbors that saved much of his crops from being perished in the deadly flames of the fire that Juan had lighted. When the flames were doused, Tuan saw which direction the fire had started from. Juan's animosity towards him was unknown to Tuan. But he let the matters rest and decided to take action only if he saw Juan repeating his dastardly act once again. That year, Tuan managed to sell the rest of his crops at a good price, but he could not make much profit for a good part of his produces had been burnt. He had a heavy heart, but he did not like to tell anyone about it. Only days later, Tuan was awakened by the sound of lamentations. He went out to find a crowd beside Juan's hut. He rushed to find that Juan's son had fallen ill. He found that the village doctor was unable to provide a cure to his illness. Tuan knew what he had to do. He untied his own horse and rode it. Then he rushed to the town that was ten miles away and fetched a more experienced doctor who lived there. This doctor was able to guess the disease correctly and provided an exact cure for it. Within hours, the boy was found to sleep soundly and Tuan went with the doctor to take him back to the town. A day later, Juan went to Tuan's hut and began to weep bitterly. He confessed to his sins but was surprised when Tuan told him that he knew about it all. "You knew that I had set fire to your crops? And still you fetched the doctor for my son?" asked the astonished Juan. Tuan nodded and said, "I did what I knew was right. Could I do wrong just because you had done so?" Juan stood up and embraced Tuan. Both men were in tears and so were the others who stood by them. From that day, Juan changed himself. Within a year, he could produce much crops in his land through his hard work. When the others asked him how he had changed so much, he only replied, "It was the goodness and love of Tuan that transformed me."

Which among the following is opposite in meaning to the word doused as used in the passage?

316626	Saturated
316627	Deluged
316628	Wet
316629	Lighted
316630	All correct

Correct Option: 316629	**Candidate Response:** 316629

203815	Verbal Ability		Raise / View Objection

Read the passage and answer the questions that follow:

Once upon a time, there lived a farmer who had a little land. His name was Tuan, and he was a very kind and good-natured person. He lived in a hut on his land with his wife and children and earned by selling whatever crops he could produce on his small land. Tuan loved to help others. Whenever someone fell ill or needed something badly, Tuan was there to help that person. If someone died in the village, Tuan assisted the family members of the deceased person in whichever way he could. If anyone fell ill at night, Tuan was right beside the village doctor to help him prepare the medicines and tend to the sick. There seemed to be none who hated this man. He appeared to be loved by one and all. But there was one person who hated Tuan with all his heart. He was Juan, a neighbour of Tuan, who lived in the land next to him. A lazy person by nature, Juan hardly put in as much effort to cultivate his land as Tuan did to produce crops in his own. So, when the harvest season arrived every year, Juan found that he had very few crops to sell. Tuan, on the other hand, earned a handsome profit through the selling of his produces. One year, Juan could no longer contain his jealousy. Just days before Tuan was to reap his harvest, Juan set fire to his crops at night. Tuan was asleep at this time, and it was only the alertness of one of his other neighbors that saved much of his crops from being perished in the deadly flames of the fire that Juan had lighted. When the flames were doused, Tuan saw which direction the fire had started from. Juan's animosity towards him was unknown to Tuan. But he let the matters rest and decided to take action only if he saw Juan repeating his dastardly act once again. That year, Tuan managed to sell the rest of his crops at a good price, but he could not make much profit for a good part of his produces had been burnt. He had a heavy heart, but he did not like to tell anyone about it. Only days later, Tuan was awakened by the sound of lamentations. He went out to find a crowd beside Juan's hut. He rushed to find that Juan's son had fallen ill. He found that the village doctor was unable to provide a cure to his illness. Tuan knew what he had to do. He untied his own horse and rode it. Then he rushed to the town that was ten miles away and fetched a more experienced doctor who lived there. This doctor was able to guess the disease correctly and provided an exact cure for it. Within hours, the boy was found to sleep soundly and Tuan went with the doctor to take him back to the town. A day later, Juan went to Tuan's hut and began to weep bitterly. He confessed to his sins but was surprised when Tuan told him that he knew about it all. "You knew that I had set fire to your crops? And still you fetched the doctor for my son?" asked the astonished Juan. Tuan nodded and said, "I did what I knew was right. Could I do wrong just because you had done so?" Juan stood up and embraced Tuan. Both men were in tears and so were the others who stood by them. From that day, Juan changed himself. Within a year, he could produce much crops in his land through his hard work. When the others asked him how he had changed so much, he only replied, "It was the goodness and love of Tuan that transformed me."

		Which of the following gave Tuan clues that Juan had set fire to his crops?
		316631 Juan had dropped a lighter with his initials in the fields.
		316632 Tuan had seen Juan carry kerosene earlier that evening.
		316633 A neighbour saw Juan sneak out at night and set fire to the crops.
		316634 The direction from which the fire had started.
		316635 Both 3 and 4
		Correct Option: 316634 **Candidate Response:** 316634
203816	Verbal Ability	Choose the correct preposition to complete the sentence: What did you make.....the lecture?
		316636 in
		316637 about
		316638 on
		316639 at
		316640 of
		Correct Option: 316640 **Candidate Response:** 316636
203817	Verbal Ability	

Raise / View Objection

Raise / View Objection

Fill in the blank with the appropriate word.

I'll help him if he.....

316641	ask
316642	asked
316643	will ask
316644	asks
316645	Not any of the above

Correct Option: 316644 | **Candidate Response:** 316643

203818 Verbal Ability

Raise / View Objection

Find if there is any grammatical error in any part of the sentence below and mark that part as your answer. If there is no error, mark 5 as your answer.

He loosened his temper/ whenever he knows/ things do not take place/ as per his planning.

316646	He loosened his temper
316647	whenever he knows
316648	things do not take place
316649	as per his planning
316650	No error

Correct Option: 316646 | **Candidate Response:** 316648

203819 Verbal Ability

Find if there is any grammatical error in any part of the sentence below and mark that part as your answer. If there is no error mark 5 as your answer

So longer as/you are honest/and forthright, they will/support you in this task.

316651	So longer as
316652	you are honest
316653	and forthright, they will
316654	support you in this task
316655	No error

Correct Option: 316651 | **Candidate Response:** 316653

Raise / View Objection

203820 | Verbal Ability

Find if there is any grammatical error in any part of the sentence below and mark that part as your answer. If there is no error mark 5 as your answer.

One of the party/ members were dismissed/ for speaking against/ the leader.

316656	One of the party
316657	members were dismissed
316658	for speaking against
316659	the leader
316660	No error

Raise / View Objection

		Correct Option: 316657	**Candidate Response:** 316659

203821	Verbal Ability	Find if there is any grammatical error in any part of the sentence below and mark that part as your answer. If there is no error mark 5 as your answer. His father promised to/ give him anything what he/wants if he/ passes in the examination.	Raise / View Objection

316661	His father promised to
316662	give him anything what he
316663	wants if he
316664	passes in the examination.
316665	No error

Correct Option: 316662	**Candidate Response:** 316665

203822	Verbal Ability	Find if there is any grammatical error in any part of the sentence below and mark that part as your answer. If there is no error mark 5 as your answer. Mahatma Gandhi did not solve/ all the problems of the future/ but he did solve/ problems of his own age.	Raise / View Objection

316666	Mahatma Gandhi did not solve
316667	all the problems of the future
316668	but he did solve
316669	problems of his own age
316670	No error

		Correct Option: 316667	**Candidate Response:** 316668

203823	Verbal Ability	Find the correctly spelt word. 1) quentiscence 2) quintecence 3) quintissense 4) quintecsence 5) quintessence	Raise / View Objection
		316671: 1	
		316672: 2	
		316673: 3	
		316674: 4	
		316675: 5	
		Correct Option: 316675	**Candidate Response:** 316673

203824	Verbal Ability		Raise / View Objection

The five sentences labelled (1, 2, 3, 4, 5) given in this question, when properly sequenced, form a coherent paragraph. Each sentence is labelled with a number. Decide on the proper order for the sentences and key in this sequence of five numbers as your answer.

1. Scientists have for the first time managed to edit genes in. a human embryo to repair a genetic mutation, fueling hopes that such procedures may one day be available outside laboratory conditions.
2. The cardiac disease causes sudden death in otherwise healthy young athletes and affects about one in 500 people overall.
3. Correcting the mutation in the gene would not only ensure that the child is healthy but also prevents transmission of the mutation to future generations.
4. It is caused by a mutation in a particular gene and a child will suffer from the condition even if it inherits only one copy of the mutated gene.
5. In results announced in Nature this week, scientists fixed a mutation that thickens the heart muscle, a condition called hypertrophic cardiomyopathy.

316676	1,4,3,2,5
316677	1,5,3,4,2
316678	1,4,5,2,3
316679	1,3,2,5,4
316680	1,5,2,4,3

Correct Option: 316680	**Candidate Response:** 316678

203825	Verbal Ability		Raise / View Objection

The five sentences labelled (1, 2, 3, 4, 5) given in this question, when properly sequenced, form a coherent paragraph. Each sentence is labelled with a number. Decide on the proper order for the sentences and key in this sequence of five numbers as your answer.

1. Like a driver changing tire in the middle of the highway, they hope an oncoming vehicle will not hit them before their work is done.
2. Some business executives have adapted a veil and see attitude.
3. Others are too busy bailing themselves out of trouble caused by the changes that have taken place around them to have any time to reflect on the future.
4. Like deer caught in the headlight of an oncoming truck, they risk being turn over.
5. Discussion with several executives in both situation shows that they recognize the danger is not applying them to understanding the shape of future.

316681	4,5,1,3,2
316682	5,1,4,3,2
316683	2,5,1,3,4
316684	3,4,5,2,1
316685	2,4,3,1,5

Correct Option: 316685	**Candidate Response:** 316683

203826 Verbal Ability

Raise / View Objection

The five sentences labelled (1, 2, 3, 4, 5) given in this question, when properly sequenced, form a coherent paragraph. Each sentence is labelled with a number. Decide on the proper order for the sentences and key in this sequence of five numbers as your answer.

1. We have paid a terrible price for our education such as it.
2. Wonder is marvellous but is also cruel, cruel, cruel.
3. We have educated ourselves into world from which wonder has been banished.
4. Of course wonder is costly because it is antithesis of the anxiously worshiped security.
5. The magician world view in so far as it exists, has taken flight into science.

316686	2,1,5,3,4
316687	1,5,4,3,2
316688	2,1,3,4,5
316689	3,1,4,5,2
316690	4,2,1,3,5

Correct Option: 316690	**Candidate Response:** 316689

203827 Verbal Ability

Raise / View Objection

The five sentences labelled (1, 2, 3, 4, 5) given in this question, when properly sequenced, form a coherent paragraph. Each sentence is labelled with a number. Decide on the proper order for the sentences and key in this sequence of five numbers as your answer.

1.People started fearing a famine.
2. The monsoon failed and water tanks became almost empty
3. Monsoon turned out to be unusually abundant and the danger was averted.
4. So, no grain could be sown by the farmers in their fields.
5. Farmers look anxiously for the next monsoon.

316691	5,4,1,3,2
316692	3,4,5,1,2
316693	4,2,3,5,1
316694	2,3,4,5,1
316695	2,4,1,5,3

Correct Option: 316695	**Candidate Response:** 316691

203828	Verbal Ability	Fill in the blank with the proper words given below. No, Rama is not at home, he ..... just ..... for shopping. 316696 is/ gone 316697 was /going 316698 had/ gone 316699 will have/be going 316700 has/ gone **Correct Option:** 316700 **Candidate Response:** 316697	Raise / View Objection
203829	Verbal Ability	Identify the correct indirect speech form of the following sentence The old woman said to the boy, 'Please help me till he returns.' 316701 The old woman told the boy, Please help me till he returns.' 316702 The old woman said that she may please help till he returns. 316703 The old women asked that a boy may help her till he returns. 316704 The old woman ordered the boy to help him till he returned. 316705 The old woman requested to the boy to help her till he returned. **Correct Option:** 316705 **Candidate Response:** 316704	Raise / View Objection
203830	Verbal Ability		

Raise / View Objection

Choose the correct alternative to replace the bold phrase in the following sentence.

I cannot force her **to playing**.

316706	In playing
316707	For play
316708	Over the play
316709	With play
316710	To play

Correct Option: 316710	**Candidate Response:** 316710

203831 Verbal Ability

Raise / View Objection

Select the most appropriate meaning of the underlined idiom in the given sentence. Srilanka's problem boils down to just one thing – lack of infrastructure for agriculture.

316711	heats up to
316712	adapts to something
316713	as a result
316714	fulfills something
316715	sums up to

Correct Option: 316715	**Candidate Response:** 316715

203832 Verbal Ability

		Pick the correct grammatical sentence. 1. The bouquet of flowers were beautiful. 2. The bouquet of flowers was beautiful. 3. The bouquet of flowers are beautiful. 4. The bouquet of flowers is beautifuller. 5. The bouquet of flowers am beautifuller. 316716: 1 316717: 2 316718: 3 316719: 4 316720: 5 **Correct Option:** 316717 **Candidate Response:** 316718	Raise / View Objection
203833	Verbal Ability	Find the most appropriate meaning of the given idiom. "Work against the clock" 316721: work late in the night 316722: work in great hurry 316723: work against all problems 316724: work with concentration 316725: work with dedication **Correct Option:** 316722 **Candidate Response:** 316722	Raise / View Objection

203834	Verbal Ability	Rearrange the following six sentences (A), (B), (C), (D), (E) and (F) in a proper sequence to form a meaningful paragraph. Then answer the question that follows. A. They had gone fishing in a creek deep inside the forest. B. A tiger killed two fishermen in the Sunderbans last Monday. C. But there was no trace of the missing fishermen. D. At last the party decided to search the creeks, where they discovered their mauled halfeaten bodies. E. The search party combed the regular fishing areas for two days. F. When they didn't return home in the evening, a search party was formed by the villagers. Which of the following should be the FIFTH statement after rearrangement?	Raise / View Objection

316726	A
316727	B
316728	C
316729	F
316730	E

Correct Option: 316728	**Candidate Response:** 316729

203835	Verbal Ability		Raise / View Objection

Read the following passage carefully and answer the question that follows.

For generations, companies have been selling fair skin to young Indian women, promising better marriage and employment prospects. However, over the last few years, men have became a favoured target audience. This followed the realisation that the Indian alpha male, denied a choice in malespecific grooming products, had been using women's fairness creams all along. Until the mid-2000s, deodorants and shaving creams were the only grooming products advertised for men. But India's largest consumer goods companies sensed an opportunity, and launched a slew of fairness products for male consumers.

In India, as in other parts of the world, light skin is the culturally accepted and endorsed form of beauty, and children absorb this message at a young age. According to a 2015 research report by Nielsen, urban Indian men believe that fair skin can improve professional prospects. The cultural pressure to look fair, argues Kiran Khalap, branding expert and founder at communications consultancy Chlorophyll, is something inherent in our society, not manufactured by companies. "And it is certainly not restricted to India: China and Japan have had skin-whitening products for centuries, well before they met Western 'white' people," he said. However, there is a growing awareness among consumers that companies are exploiting their insecurities, and critics have taken some of the biggest fairness brands, and the celebrities who endorse them, to task for their casual discrimination.

Earlier this month, Bollywood actor Abhay Deol took to Facebook to trounce his fellow actors who earn millions from endorsing fairness creams. This comes a few years after actress Nandita Das launched the "Dark is Beautiful" campaign to encourage Indians to embrace a wider definition of beauty. These efforts are slowly making a difference, increasing awareness and encouraging consumers to take pride in their natural skin tones. That means Indian companies will eventually have to change their approach. "My sense is that brands will wake up to the new reality, and you will see propositions reworked around clearer skin (and) glow, rather than pure fairness," Leo Burnett's Sinha said.

Rajesh Krishnamurthy, business head for the consumer product division at The Himalaya Drug Company, believes that over time the men's grooming category will evolve to include a wider range of products, including those for normal skin, just like in the women's skin care category. "Companies are increasingly realising that you cannot continue to bullshit consumers anymore; these are educated young men who will question what you sell to them," said Shantanu Deshpande, co-founder and CEO of the male-grooming startup Bombay Shaving Company.

What is the central idea of the passage?

A. Though people endorsed skin fairness products, they are now realising that they are being taken for a ride by such products.

B. Only men ardently use whitening creams to boost their personality.

C. The brand marketing of fairness prdoduct companies are evolving to appease the target audience of India.

D. Brands are frivolous when it comes to campaigning of their beauty products.

E. Not any of the above

316731	A
316732	B
316733	C
316734	D
316735	E

Correct Option: 316731	**Candidate Response:** 316733

203836	Verbal Ability		Raise / View Objection

Read the following passage carefully and answer the question that follows.

For generations, companies have been selling fair skin to young Indian women, promising better marriage and employment prospects. However, over the last few years, men have became a favoured target audience. This followed the realisation that the Indian alpha male, denied a choice in malespecific grooming products, had been using women's fairness creams all along. Until the mid-2000s, deodorants and shaving creams were the only grooming products advertised for men. But India's largest consumer goods companies sensed an opportunity, and launched a slew of fairness products for male consumers.

In India, as in other parts of the world, light skin is the culturally accepted and endorsed form of beauty, and children absorb this message at a young age. According to a 2015 research report by Nielsen, urban Indian men believe that fair skin can improve professional prospects. The cultural pressure to look fair, argues Kiran Khalap, branding expert and founder at communications consultancy Chlorophyll, is something inherent in our society, not manufactured by companies. "And it is certainly not restricted to India: China and Japan have had skin-whitening products for centuries, well before they met Western 'white' people," he said. However, there is a growing awareness among consumers that companies are exploiting their insecurities, and critics have taken some of the biggest fairness brands, and the celebrities who endorse them, to task for their casual discrimination.

Earlier this month, Bollywood actor Abhay Deol took to Facebook to trounce his fellow actors who earn millions from endorsing fairness creams. This comes a few years after actress Nandita Das launched the "Dark is Beautiful" campaign to encourage Indians to embrace a wider definition of beauty. These efforts are slowly making a difference, increasing awareness and encouraging consumers to take pride in their natural skin tones. That means Indian companies will eventually have to change their approach. "My sense is that brands will wake up to the new reality, and you will see propositions reworked around clearer skin (and) glow, rather than pure fairness," Leo Burnett's Sinha said.

Rajesh Krishnamurthy, business head for the consumer product division at The Himalaya Drug Company, believes that over time the men's grooming category will evolve to include a wider range of products, including those for normal skin, just like in the women's skin care category. "Companies are increasingly realising that you cannot continue to bullshit consumers anymore; these are educated young men who will question what you sell to them," said Shantanu Deshpande, co-founder and CEO of the male-grooming startup Bombay Shaving Company.

What were the findings of the 2015 research report by Nielsen?

A. Indian urban men presumed that being fair enhanced their professional opportunities.

B. Indian urban men believed that being fair would give them better marriage and employment contracts.

C. Indian urban men would eventually question the logic behind male-grooming product advertisements.

D. Indian urban men do not endorse the concept of fairness helping them in their personal and professional life.

E. Not any of the above

316736	A
316737	B
316738	C
316739	D
316740	E

Correct Option: 316736	**Candidate Response:** 316737

203837	Verbal Ability		Raise / View Objection

Read the following passage carefully and answer the question that follows.

For generations, companies have been selling fair skin to young Indian women, promising better marriage and employment prospects. However, over the last few years, men have became a favoured target audience. This followed the realisation that the Indian alpha male, denied a choice in malespecific grooming products, had been using women's fairness creams all along. Until the mid-2000s, deodorants and shaving creams were the only grooming products advertised for men. But India's largest consumer goods companies sensed an opportunity, and launched a slew of fairness products for male consumers.

In India, as in other parts of the world, light skin is the culturally accepted and endorsed form of beauty, and children absorb this message at a young age. According to a 2015 research report by Nielsen, urban Indian men believe that fair skin can improve professional prospects. The cultural pressure to look fair, argues Kiran Khalap, branding expert and founder at communications consultancy Chlorophyll, is something inherent in our society, not manufactured by companies. "And it is certainly not restricted to India: China and Japan have had skin-whitening products for centuries, well before they met Western 'white' people," he said. However, there is a growing awareness among consumers that companies are exploiting their insecurities, and critics have taken some of the biggest fairness brands, and the celebrities who endorse them, to task for their casual discrimination.

Earlier this month, Bollywood actor Abhay Deol took to Facebook to trounce his fellow actors who earn millions from endorsing fairness creams. This comes a few years after actress Nandita Das launched the "Dark is Beautiful" campaign to encourage Indians to embrace a wider definition of beauty. These efforts are slowly making a difference, increasing awareness and encouraging consumers to take pride in their natural skin tones. That means Indian companies will eventually have to change their approach. "My sense is that brands will wake up to the new reality, and you will see propositions reworked around clearer skin (and) glow, rather than pure fairness," Leo Burnett's Sinha said.

Rajesh Krishnamurthy, business head for the consumer product division at The Himalaya Drug Company, believes that over time the men's grooming category will evolve to include a wider range of products, including those for normal skin, just like in the women's skin care category. "Companies are increasingly realising that you cannot continue to bullshit consumers anymore; these are educated young men who will question what you sell to them," said Shantanu Deshpande, co-founder and CEO of the male-grooming startup Bombay Shaving Company.

4. With reference to the passage, why exactly was "Dark is beautiful" campaign initiated?

A. To motivate Indians to ditch their liking for the fair skin and accept their inherent beauty.

B. To throw light on the sinister intentions of fairness brands.

C. To make sure that Indians do not fall prey to misleading beauty product advertisements.

D. To encourage Indians to be sympathic towards people with other skin tones.

E. Not any of the above

316741	A
316742	B
316743	C
316744	D
316745	E

Correct Option: 316741	**Candidate Response:** 316743

203838	Verbal Ability		Raise / View Objection

Read the following passage carefully and answer the question that follows.

For generations, companies have been selling fair skin to young Indian women, promising better marriage and employment prospects. However, over the last few years, men have became a favoured target audience. This followed the realisation that the Indian alpha male, denied a choice in malespecific grooming products, had been using women's fairness creams all along. Until the mid-2000s, deodorants and shaving creams were the only grooming products advertised for men. But India's largest consumer goods companies sensed an opportunity, and launched a slew of fairness products for male consumers.

In India, as in other parts of the world, light skin is the culturally accepted and endorsed form of beauty, and children absorb this message at a young age. According to a 2015 research report by Nielsen, urban Indian men believe that fair skin can improve professional prospects. The cultural pressure to look fair, argues Kiran Khalap, branding expert and founder at communications consultancy Chlorophyll, is something inherent in our society, not manufactured by companies. "And it is certainly not restricted to India: China and Japan have had skin-whitening products for centuries, well before they met Western 'white' people," he said. However, there is a growing awareness among consumers that companies are exploiting their insecurities, and critics have taken some of the biggest fairness brands, and the celebrities who endorse them, to task for their casual discrimination.

Earlier this month, Bollywood actor Abhay Deol took to Facebook to trounce his fellow actors who earn millions from endorsing fairness creams. This comes a few years after actress Nandita Das launched the "Dark is Beautiful" campaign to encourage Indians to embrace a wider definition of beauty. These efforts are slowly making a difference, increasing awareness and encouraging consumers to take pride in their natural skin tones. That means Indian companies will eventually have to change their approach. "My sense is that brands will wake up to the new reality, and you will see propositions reworked around clearer skin (and) glow, rather than pure fairness," Leo Burnett's Sinha said.

Rajesh Krishnamurthy, business head for the consumer product division at The Himalaya Drug Company, believes that over time the men's grooming category will evolve to include a wider range of products, including those for normal skin, just like in the women's skin care category. "Companies are increasingly realising that you cannot continue to bullshit consumers anymore; these are educated young men who will question what you sell to them," said Shantanu Deshpande, co-founder and CEO of the male-grooming startup Bombay Shaving Company.

Which of the following statements is not true with respect to the passage?

A. Since the inception of beauty products, men have been its most targeted audience.

B. Light skin is a culturally endorsed notion wordwide.

C. Skin whitening products exsited for centuries in China and Japan.

D. Deodrants and shaving creams were the only grooming products advertised for men till the mid-2000s.

E. Not any of the above

316746	A
316747	B
316748	C
316749	D
316750	E

Correct Option: 316746	**Candidate Response:** 316746

203839	Verbal Ability		Raise / View Objection

Read the following passage carefully and answer the question that follows.

For generations, companies have been selling fair skin to young Indian women, promising better marriage and employment prospects. However, over the last few years, men have became a favoured target audience. This followed the realisation that the Indian alpha male, denied a choice in malespecific grooming products, had been using women's fairness creams all along. Until the mid-2000s, deodorants and shaving creams were the only grooming products advertised for men. But India's largest consumer goods companies sensed an opportunity, and launched a slew of fairness products for male consumers.

In India, as in other parts of the world, light skin is the culturally accepted and endorsed form of beauty, and children absorb this message at a young age. According to a 2015 research report by Nielsen, urban Indian men believe that fair skin can improve professional prospects. The cultural pressure to look fair, argues Kiran Khalap, branding expert and founder at communications consultancy Chlorophyll, is something inherent in our society, not manufactured by companies. "And it is certainly not restricted to India: China and Japan have had skin-whitening products for centuries, well before they met Western 'white' people," he said. However, there is a growing awareness among consumers that companies are exploiting their insecurities, and critics have taken some of the biggest fairness brands, and the celebrities who endorse them, to task for their casual discrimination.

Earlier this month, Bollywood actor Abhay Deol took to Facebook to trounce his fellow actors who earn millions from endorsing fairness creams. This comes a few years after actress Nandita Das launched the "Dark is Beautiful" campaign to encourage Indians to embrace a wider definition of beauty. These efforts are slowly making a difference, increasing awareness and encouraging consumers to take pride in their natural skin tones. That means Indian companies will eventually have to change their approach. "My sense is that brands will wake up to the new reality, and you will see propositions reworked around clearer skin (and) glow, rather than pure fairness," Leo Burnett's Sinha said.

Rajesh Krishnamurthy, business head for the consumer product division at The Himalaya Drug Company, believes that over time the men's grooming category will evolve to include a wider range of products, including those for normal skin, just like in the women's skin care category. "Companies are increasingly realising that you cannot continue to bullshit consumers anymore; these are educated young men who will question what you sell to them," said Shantanu Deshpande, co-founder and CEO of the male-grooming startup Bombay Shaving Company.

Choose a similar word in meaning to the word “trounce”

A. Vacillation

B. Temerity

C. Lambaste

D. Nefarious

E. Not any of the above

316751	A
316752	B
316753	C
316754	D
316755	E

Correct Option: 316753	**Candidate Response:** 316751

203840	Verbal Ability		Raise / View Objection

Read the passage carefully and answer the question that follows.

Emotions often trump reason. The Cauvery water dispute is turning out to be less about water and irrigation and more about linguistic chauvinism and regional identity. Nothing else can explain the mindless violence in Karnataka and Tamil Nadu over the Supreme Court order asking the former to release water to the latter, keeping in view the distress situation in both States in a season of deficit rainfall. Many of the acts of violence have been perpetuated in the two States by chauvinistic, fringe organizations that have little to do with the farming community or its interests. It is clear that there is insufficient water in Karnataka's reservoirs to meet the full irrigation needs of both states. The point of the Supreme Court order was to make the States share their distress and not to magically fulfil the needs of farmers on both sides. But political parties and some media houses, especially regional language television channels, have sought to portray the issue as one that pits the people of one State against that of the other. Indeed, the two major national parties, the Congress and the Bharatiya Janata Party, have taken different stands in the two States on this issue. No party or State government appears to believe it can afford to be seen as taking even so much as a conciliatory step toward defusing the crisis. On some previous occasions when Karnataka released water in a distress year the State government did so quietly so as to not give chauvinistic elements any opportunity to inflame passions. Cauvery is an inter-State dispute, but this is no reason to turn the issue into a raging controversy that draws the peoples of the two States into confrontation!

What was the purpose behind the Supreme Court's order regarding Cauvery water?

A. To solve the irrigation needs faced by the farmers of Tamil Nadu.

B. That the two states share their distress due to shortage of water.

C. To fulfil the needs of the farmers in both states.

D. To solve the irrigation needs faced by the farmers of Karnataka.

E. Not any of the above

316756	A
316757	B
316758	C
316759	D
316760	E

Correct Option: 316757	**Candidate Response:** 316757

View Objection Summary